Math Practice - Grade 1

M10 Shapes, halves, and fourths - Make a shape

M10 1.G.A.1, 1.G.A.2, 1.G.A.3

Name: _____ Date: _____

Which two shapes make the shape? Circle A, B, or C.

Example: Which two shapes make the triangle?

How: Put the two small shapes together in your head. The sides that touch disappear, and the outside edge is the new shape.

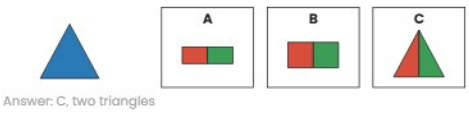

Answer: C, two triangles

---

1 **Which two shapes make the triangle?**

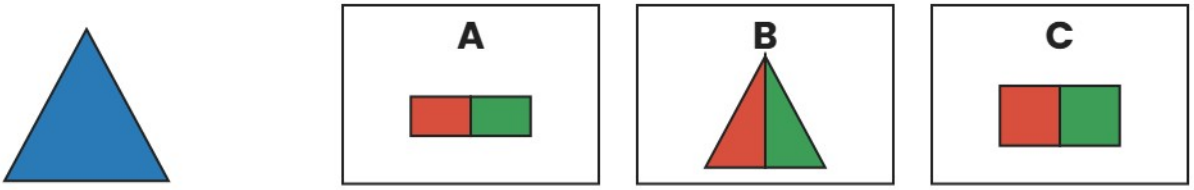

---

2 **Which two shapes make the rectangle?**

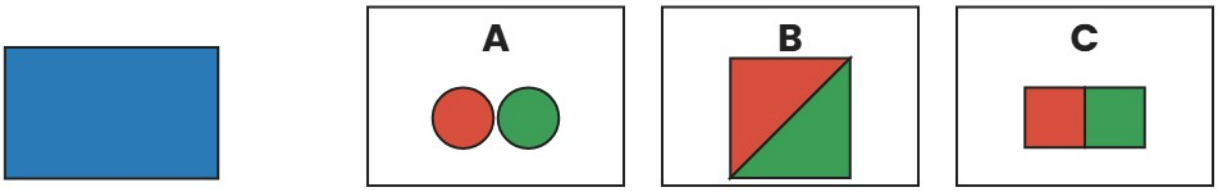

---

3 **Which two shapes make the triangle?**

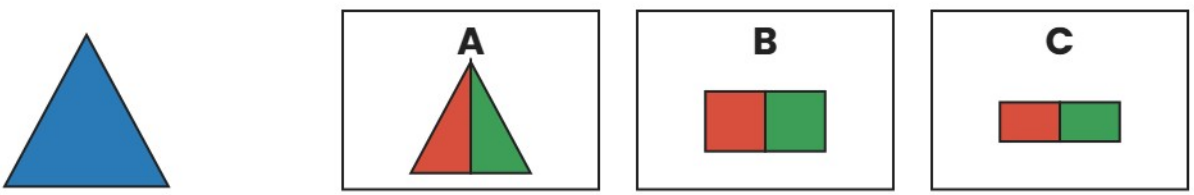

---

4 **Which two shapes make the square?**

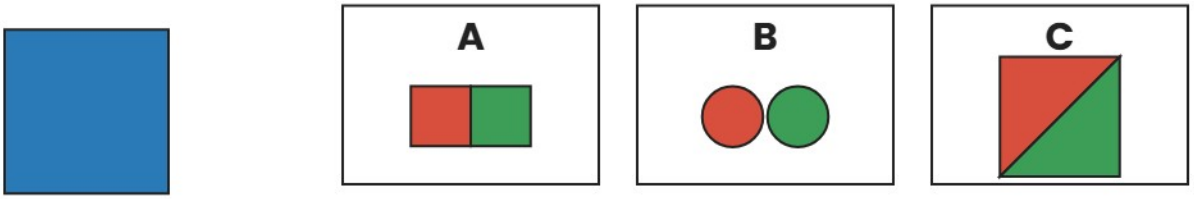

Math Practice - Grade 1

M10 Shapes, halves, and fourths - Make a shape

M10 1.G.A.1, 1.G.A.2, 1.G.A.3

Name: _____ Date: _____

Which two shapes make the shape? Circle A, B, or C.

Example: Which two shapes make the triangle?

How: Put the two small shapes together in your head. The sides that touch disappear, and the outside edge is the new shape.

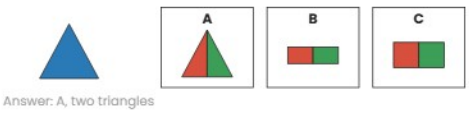

Answer: A, two triangles

---

1 **Which two shapes make the rectangle?**

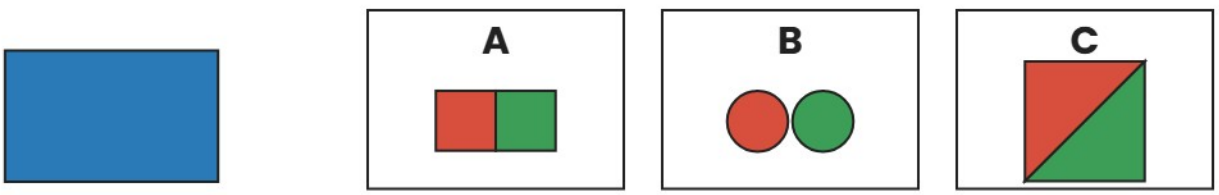

---

2 **Which two shapes make the square?**

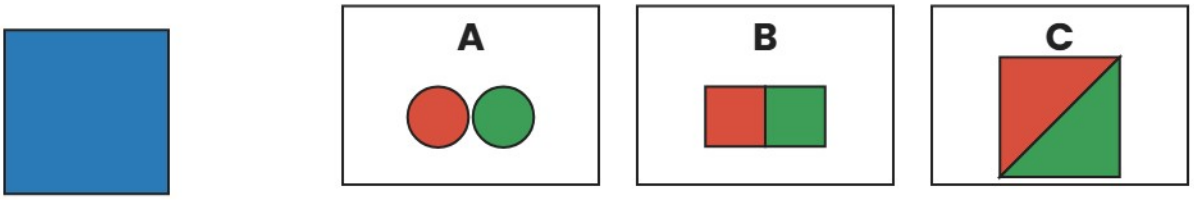

---

3 **Which two shapes make the square?**

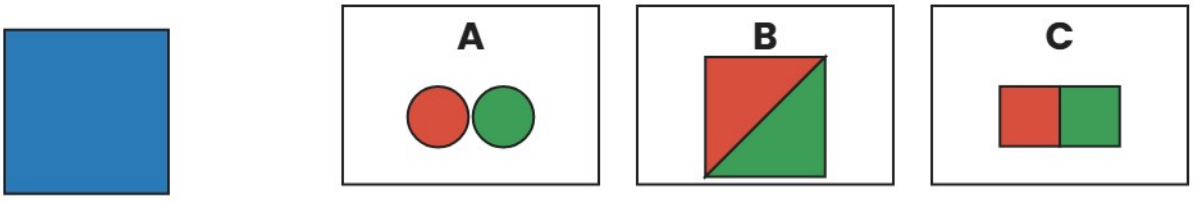

---

4 **Which two shapes make the triangle?**

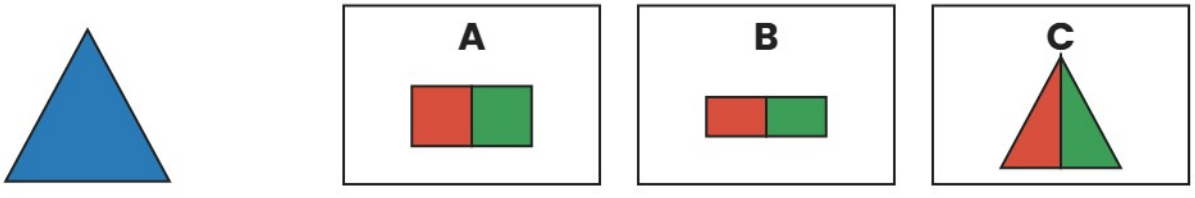

Math Practice - Grade 1

M10 Shapes, halves, and fourths - Make a shape

M10 1.G.A.1, 1.G.A.2, 1.G.A.3

Name: _____ Date: _____

Which two shapes make the shape? Circle A, B, or C.

Example: Which two shapes make the triangle?

How: Put the two small shapes together in your head. The sides that touch disappear, and the outside edge is the new shape.

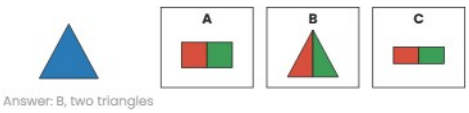

Answer: B, two triangles

---

1 **Which two shapes make the rectangle?**

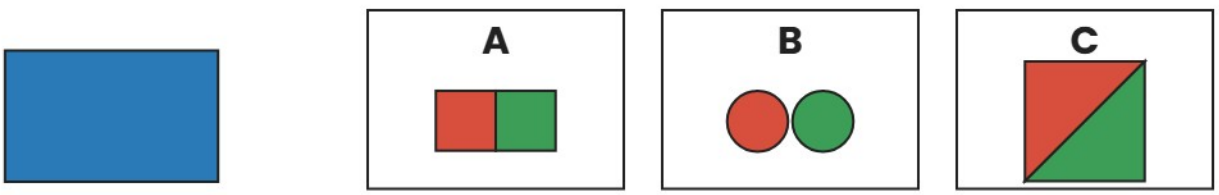

---

2 **Which two shapes make the rectangle?**

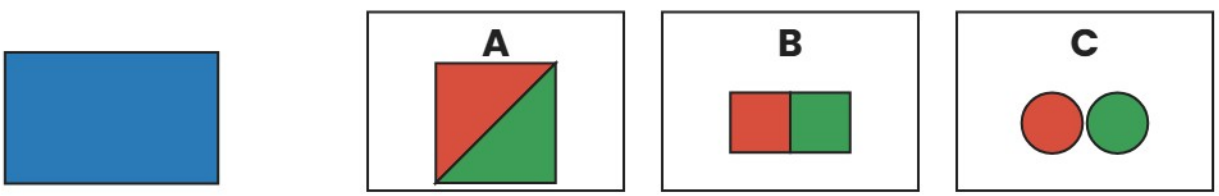

---

3 **Which two shapes make the rectangle?**

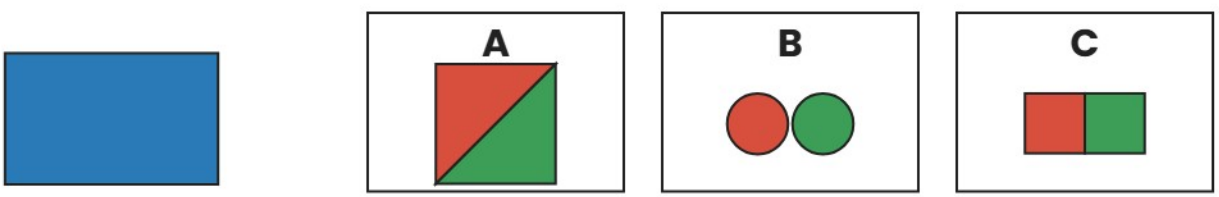

---

4 **Which two shapes make the triangle?**

