Math Practice - Grade 1

M1 Count to 120 - Number line

M1 1.NBT.A.1

Name: _____ Date: _____

Write the missing number on the number line.

Example: Write the missing number on the number line.

How: Count on by ones from the first number. The missing number is the one you skip.

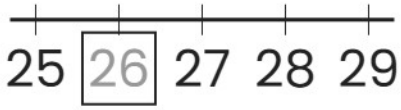

1

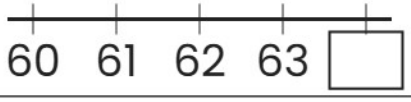

2

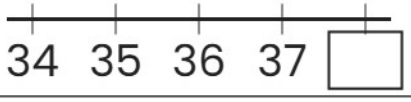

3

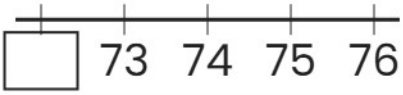

4

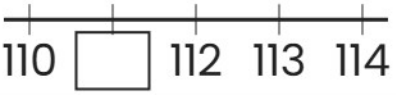

5

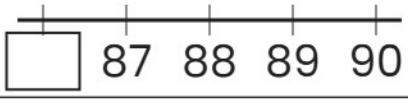

6

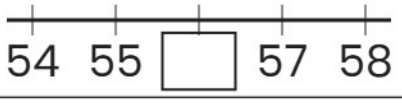

7

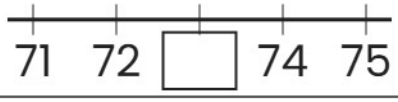

8

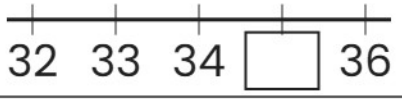

9

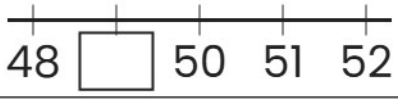

10

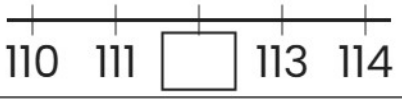

11

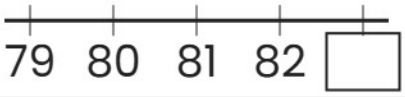

12

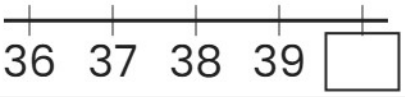

13

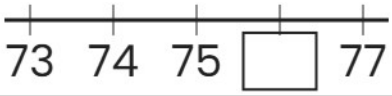

14

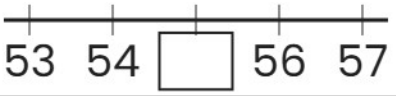

15

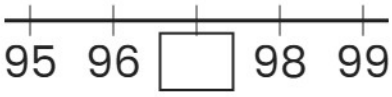

16

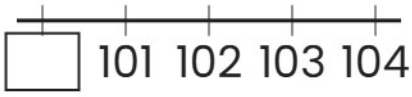

Math Practice - Grade 1

M1 Count to 120 - Number line

M1 1.NBT.A.1

Name: _____ Date: _____

Write the missing number on the number line.

Example: Write the missing number on the number line.

How: Count on by ones from the first number. The missing number is the one you skip.

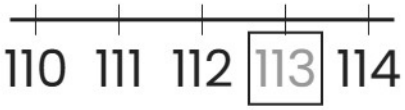

1

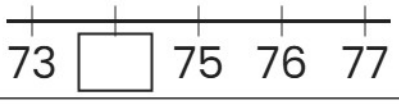

2

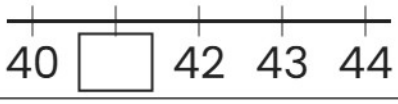

3

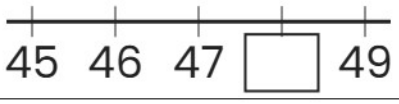

4

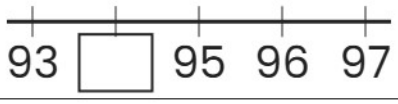

5

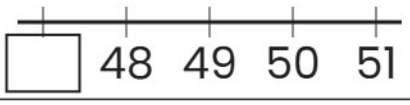

6

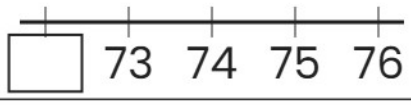

7

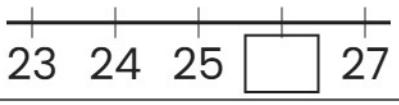

8

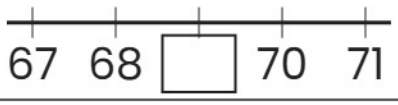

9

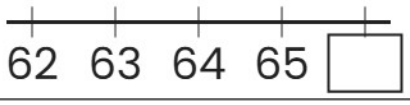

10

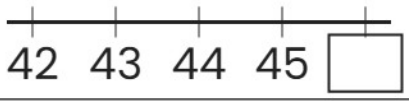

11

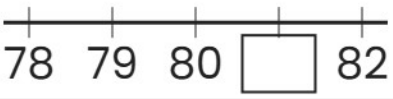

12

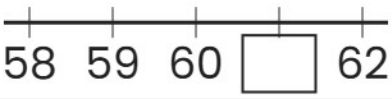

13

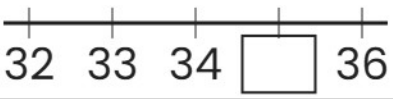

14

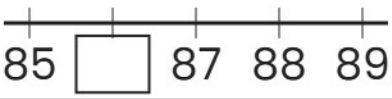

15

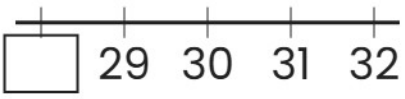

16

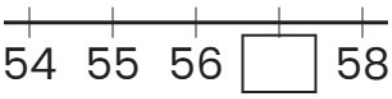

Math Practice - Grade 1

M1 Count to 120 - Number line

M1 1.NBT.A.1

Name: _____ Date: _____

Write the missing number on the number line.

Example: Write the missing number on the number line.

How: Count on by ones from the first number. The missing number is the one you skip.

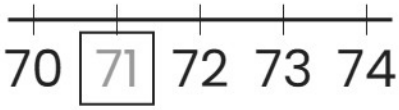

1

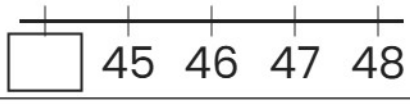

2

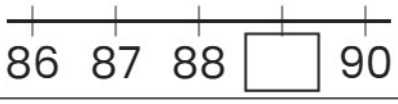

3

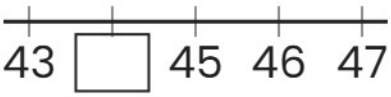

4

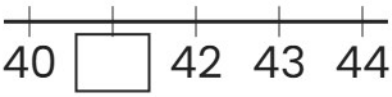

5

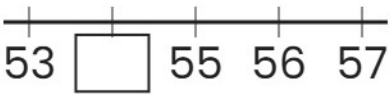

6

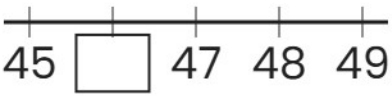

7

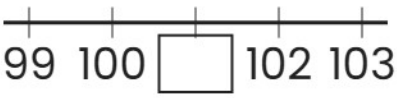

8

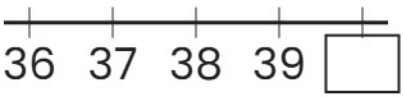

9

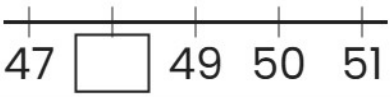

10

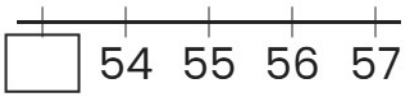

11

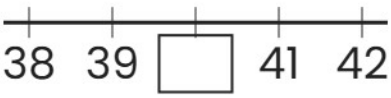

12

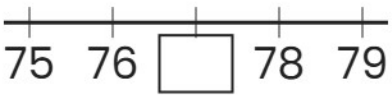

13

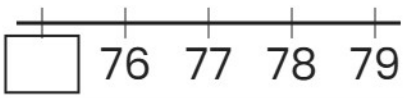

14

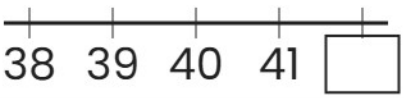

15

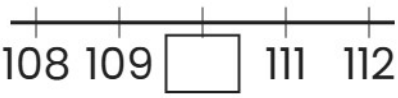

16

