Math Practice - PreK

PM-7 Longer, taller, heavier, bigger

PM-7 IELDS 7.A.ECa, 7.A.ECb, 7.A.ECc, 7.B.ECa, 7.C.ECa, 7.C.ECb

Name: _____ Date: _____

Circle the longer, taller, bigger, or heavier one. Write 1, 2, 3 from shortest to longest.

1 **Circle the longer bar.**

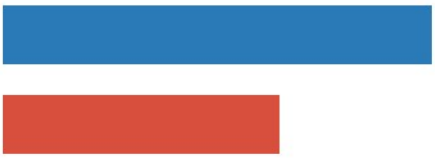

Top

Bottom

2 **Circle the taller bar.**



Left Right

3 **Circle the bigger shape.**



Left Right

4 **Write 1, 2, 3 from shortest to longest.**

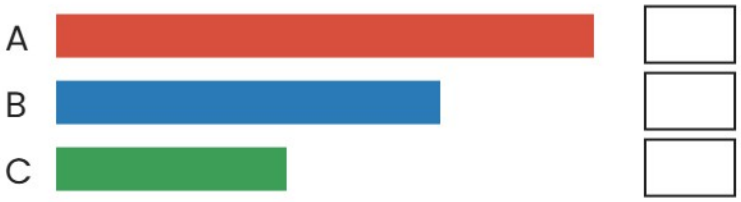

5 **Circle the heavier one.**



Left
Brick

Right
Balloon

Math Practice - PreK

PM-7 Longer, taller, heavier, bigger

PM-7 IELDS 7.A.ECa, 7.A.ECb, 7.A.ECc, 7.B.ECa, 7.C.ECa, 7.C.ECb

Name: _____ Date: _____

Circle the longer, taller, bigger, or heavier one. Write 1, 2, 3 from shortest to longest.

1 **Circle the longer bar.**



Top

Bottom

2 **Circle the taller bar.**



Left Right

3 **Circle the bigger shape.**



Left Right

4 **Write 1, 2, 3 from shortest to longest.**

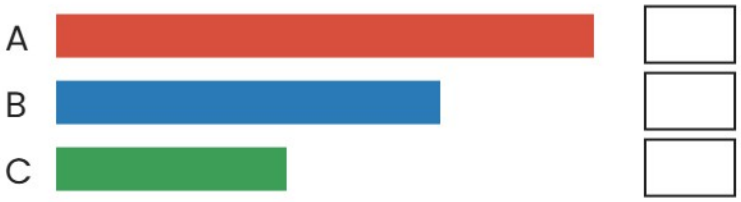

5 **Circle the heavier one.**



Left
Brick

Right
Balloon

Math Practice - PreK

PM-7 Longer, taller, heavier, bigger

PM-7 IELDS 7.A.ECa, 7.A.ECb, 7.A.ECc, 7.B.ECa, 7.C.ECa, 7.C.ECb

Name: _____ Date: _____

Circle the longer, taller, bigger, or heavier one. Write 1, 2, 3 from shortest to longest.

1 **Circle the longer bar.**



Top

Bottom

2 **Circle the taller bar.**



Left Right

3 **Circle the bigger shape.**



Left Right

4 **Write 1, 2, 3 from shortest to longest.**

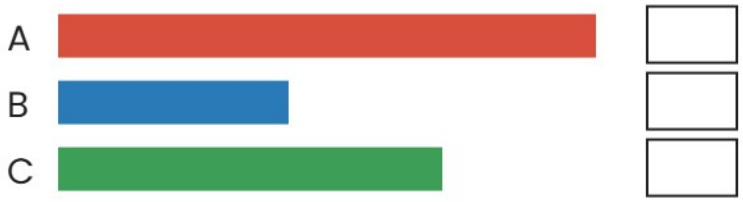

5 **Circle the heavier one.**



Left
Watermelon

Right
Apple