Math Practice - PreK

PM-6 Guess how many

PM-6 IELDS 6.C.ECa

Name: _____ Date: _____

Guess first, then count. Circle a few or a lot, then write the number. 3 or fewer is a few. 4 or more is a lot.

1 **Guess first, then count.**



a few | a lot | Count: ☐

---

2 **Guess first, then count.**

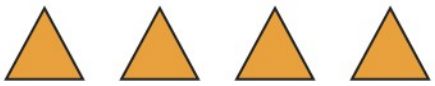

a few | a lot | Count: ☐

---

3 **Guess first, then count.**



a few | a lot | Count: ☐

---

4 **Guess first, then count.**



a few | a lot | Count: ☐

---

5 **Guess first, then count.**

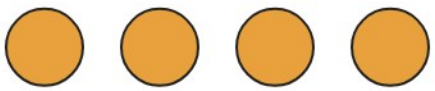

a few | a lot | Count: ☐

---

6 **Guess first, then count.**

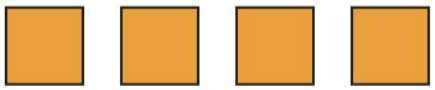

a few | a lot | Count: ☐

---

7 **Guess first, then count.**



a few | a lot | Count: ☐

Math Practice - PreK

PM-6 Guess how many

PM-6 IELDS 6.C.ECa

Name: _____ Date: _____

Guess first, then count. Circle a few or a lot, then write the number. 3 or fewer is a few. 4 or more is a lot.

1 **Guess first, then count.**



a few | a lot | Count: ☐

---

2 **Guess first, then count.**

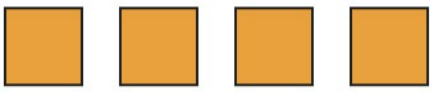

a few | a lot | Count: ☐

---

3 **Guess first, then count.**

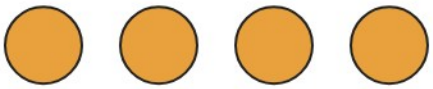

a few | a lot | Count: ☐

---

4 **Guess first, then count.**

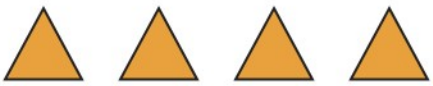

a few | a lot | Count: ☐

---

5 **Guess first, then count.**



a few | a lot | Count: ☐

---

6 **Guess first, then count.**



a few | a lot | Count: ☐

---

7 **Guess first, then count.**



a few | a lot | Count: ☐

Math Practice - PreK

PM-6 Guess how many

PM-6 IELDS 6.C.ECa

Name: _____ Date: _____

Guess first, then count. Circle a few or a lot, then write the number. 3 or fewer is a few. 4 or more is a lot.

1 **Guess first, then count.**



a few | a lot | Count: ☐

---

2 **Guess first, then count.**



a few | a lot | Count: ☐

---

3 **Guess first, then count.**



a few | a lot | Count: ☐

---

4 **Guess first, then count.**



a few | a lot | Count: ☐

---

5 **Guess first, then count.**

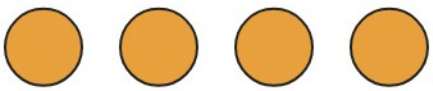

a few | a lot | Count: ☐

---

6 **Guess first, then count.**



a few | a lot | Count: ☐

---

7 **Guess first, then count.**



a few | a lot | Count: ☐