Math Practice - PreK

PM-5 Share fairly

PM-5 IELDS 6.B.ECe

Name: _____ Date: _____

Share the treats fairly. Draw the same number on each plate.

1 **Share fairly. Draw the same number on each plate.**

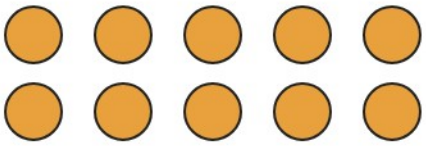



Plate 1



Plate 2

2 **Is the sharing fair? Circle Yes or No.**

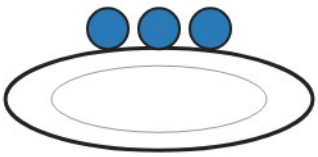

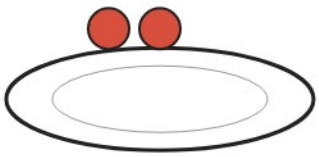

Yes

No

3 **Share fairly. Draw the same number on each plate.**

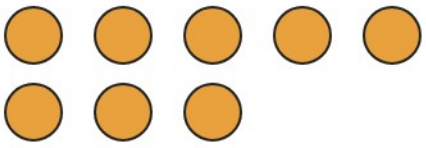



Plate 1



Plate 2

4 **Is the sharing fair? Circle Yes or No.**

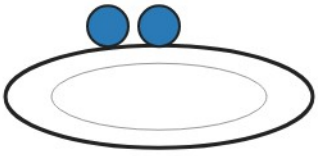

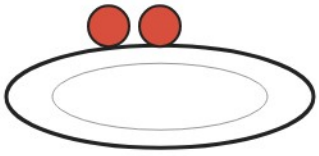

Yes

No

Math Practice - PreK

PM-5 Share fairly

PM-5 IELDS 6.B.ECe

Name: _____ Date: _____

Share the treats fairly. Draw the same number on each plate.

1 **Share fairly. Draw the same number on each plate.**

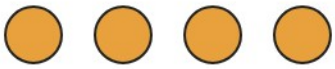



Plate 1



Plate 2

2 **Is the sharing fair? Circle Yes or No.**

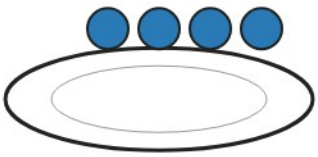

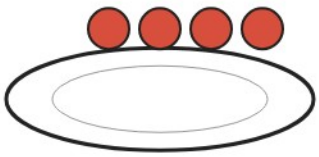

Yes

No

3 **Share fairly. Draw the same number on each plate.**

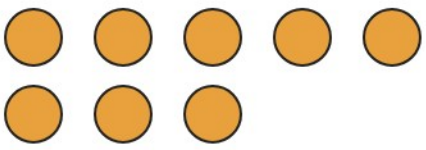



Plate 1



Plate 2

4 **Is the sharing fair? Circle Yes or No.**

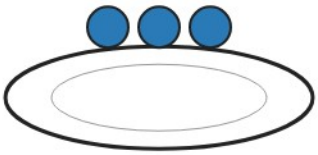

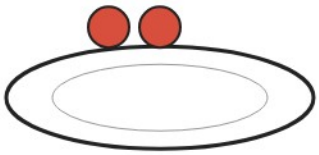

Yes

No

Math Practice - PreK

PM-5 Share fairly

PM-5 IELDS 6.B.ECe

Name: _____ Date: _____

Share the treats fairly. Draw the same number on each plate.

1 **Share fairly. Draw the same number on each plate.**

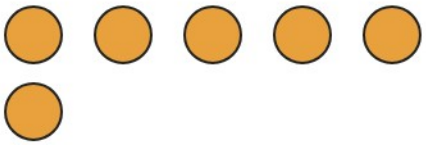



Plate 1



Plate 2

2 **Is the sharing fair? Circle Yes or No.**

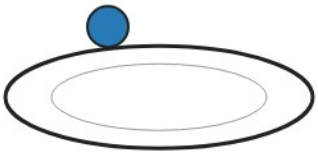

Yes

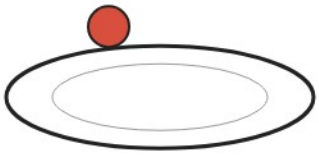

No

3 **Share fairly. Draw the same number on each plate.**

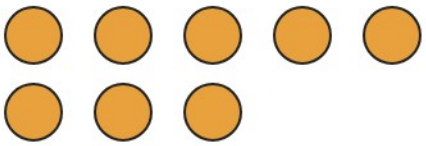



Plate 1



Plate 2

4 **Is the sharing fair? Circle Yes or No.**

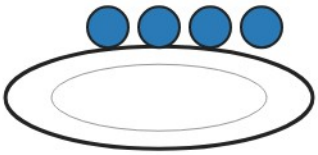

Yes

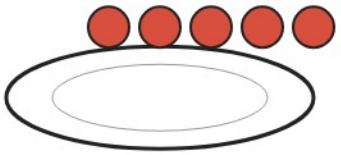

No