Math Practice - PreK

PM-4 Put together and take apart (to 5)

PM-4 IELDS 6.B.ECa, 6.B.ECb, 6.B.ECc, 6.B.ECd

Name: _____ Date: _____

Count the shapes. Write how many in the box.

1 **Put together. How many in all?**



2 **Take away. How many are left?**



3 **Put together. How many in all?**



4 **Take away. How many are left?**



5 **Put together. How many in all?**



6 **Take away. How many are left?**

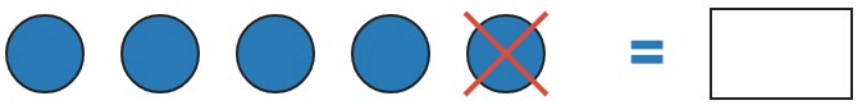

7 **Put together. How many in all?**



Math Practice - PreK

PM-4 Put together and take apart (to 5)

PM-4 IELDS 6.B.ECa, 6.B.ECb, 6.B.ECc, 6.B.ECd

Name: _____ Date: _____

Count the shapes. Write how many in the box.

1 **Put together. How many in all?**



---

2 **Take away. How many are left?**



---

3 **Put together. How many in all?**



---

4 **Take away. How many are left?**



---

5 **Put together. How many in all?**



---

6 **Take away. How many are left?**



---

7 **Put together. How many in all?**



Math Practice - PreK

PM-4 Put together and take apart (to 5)

PM-4 IELDS 6.B.ECa, 6.B.ECb, 6.B.ECc, 6.B.ECd

Name: _____ Date: _____

Count the shapes. Write how many in the box.

1 **Put together. How many in all?**



2 **Take away. How many are left?**



3 **Put together. How many in all?**



4 **Take away. How many are left?**



5 **Put together. How many in all?**



6 **Take away. How many are left?**



7 **Put together. How many in all?**

