Math Practice - PreK

PM-2 How many? Zero, more, less, same

PM-2 IELDS 6.A.ECc, 6.D.ECa, 6.D.ECb

Name: _____ Date: _____

Look at the two groups. Circle the group each question asks for.

1 **Circle the group with more.**

Left



Right



---

2 **Circle the group with fewer.**

Left

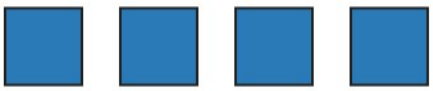

Right



---

3 **Circle Yes if the groups are the same.**

Left



Right



Yes

No

---

4 **Circle the group with zero.**

Left



Right

---

5 **Circle the group with more.**

Left



Right



---

6 **Circle the group with more.**

Left



Right



Math Practice - PreK

PM-2 How many? Zero, more, less, same

PM-2 IELDS 6.A.ECc, 6.D.ECa, 6.D.ECb

Name: _____ Date: _____

Look at the two groups. Circle the group each question asks for.

1 **Circle the group with more.**

Left

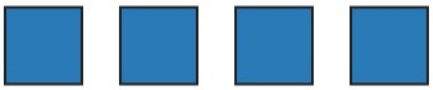

Right



---

2 **Circle the group with fewer.**

Left



Right



---

3 **Circle Yes if the groups are the same.**

Left



Right



Yes

No

---

4 **Circle the group with zero.**

Left

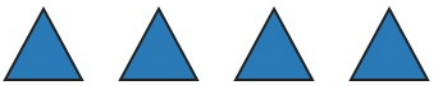

Right

---

5 **Circle the group with more.**

Left

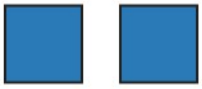

Right



---

6 **Circle the group with more.**

Left

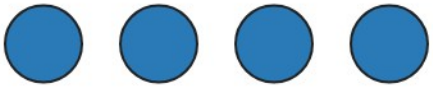

Right



Math Practice - PreK

PM-2 How many? Zero, more, less, same

PM-2 IELDS 6.A.ECc, 6.D.ECa, 6.D.ECb

Name: _____ Date: _____

Look at the two groups. Circle the group each question asks for.

1 **Circle the group with more.**

Left



Right



---

2 **Circle the group with fewer.**

Left



Right

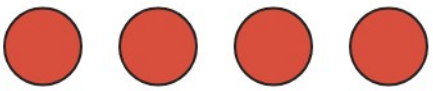

---

3 **Circle Yes if the groups are the same.**

Left



Yes

Right



No

---

4 **Circle the group with zero.**

Left

Right



---

5 **Circle the group with more.**

Left

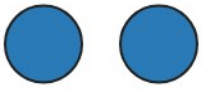

Right



---

6 **Circle the group with more.**

Left



Right

