Math Practice - PreK

PM-10 Shapes around me

PM-10 IELDS 9.A.ECa, 9.A.ECb, 9.A.ECc, 9.A.ECd, 9.A.ECe

Name: _____ Date: _____

Circle the shape each question asks for. Write how many sides it has.

1 **Circle all the circles.**



How many circles?

2 **How many sides does this shape have?**



Sides: ☐

3 **What shape is this?**



Shape: _____

4 **Circle all the circles.**



How many circles?

5 **How many sides does this shape have?**



Sides: ☐

Math Practice - PreK

PM-10 Shapes around me

PM-10 IELDS 9.A.ECa, 9.A.ECb, 9.A.ECc, 9.A.ECd, 9.A.ECe

Name: _____ Date: _____

Circle the shape each question asks for. Write how many sides it has.

1 **Circle all the squares.**



How many squares?

2 **How many sides does this shape have?**

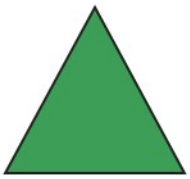

Sides: ☐

3 **What shape is this?**



Shape: _____

4 **Circle all the triangles.**



How many triangles?

5 **How many sides does this shape have?**



Sides: ☐

Math Practice - PreK

PM-10 Shapes around me

PM-10 IELDS 9.A.ECa, 9.A.ECb, 9.A.ECc, 9.A.ECd, 9.A.ECe

Name: _____ Date: _____

Circle the shape each question asks for. Write how many sides it has.

1 **Circle all the stars.**



How many stars?

---

2 **How many sides does this shape have?**

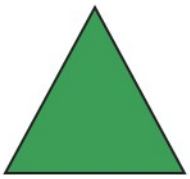

Sides: ☐

---

3 **What shape is this?**



Shape: _____

---

4 **Circle all the triangles.**



How many triangles?

---

5 **How many sides does this shape have?**



Sides: ☐