Math Practice - PreK

PM-1 Count and say numbers 1 to 5

PM-1 IELDS 6.A.ECa, 6.A.ECb, 6.A.ECd

Name: _____ Date: _____

Count the shapes. Write the number in the box.

1 **Count the squares.**



2 **Count the triangles.**



3 **Count the squares.**

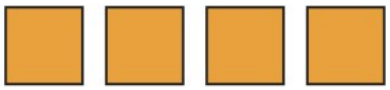

4 **Count the circles.**

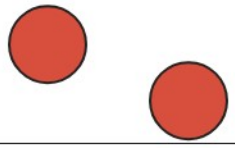

5 **Count the stars.**



6 **Count the stars.**



7 **Count the triangles.**



8 **Count the stars.**



9 **Count the stars.**



10 **Count the stars.**



11 **Count the circles.**



12 **Count the squares.**

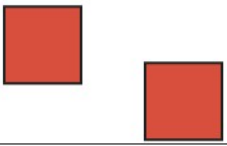

13 **Count the circles.**



14 **Count the triangles.**

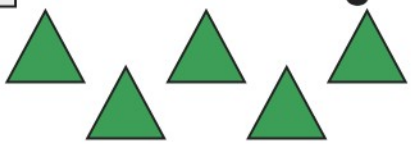

15 **Count the circles.**

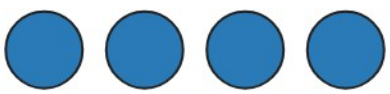

16 **Count the squares.**



Math Practice - PreK

PM-1 Count and say numbers 1 to 5

PM-1 IELDS 6.A.ECa, 6.A.ECb, 6.A.ECd

Name: _____ Date: _____

Count the shapes. Write the number in the box.

1 **Count the squares.**



2 **Count the triangles.**

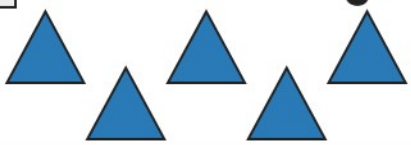

3 **Count the triangles.**



4 **Count the stars.**



5 **Count the squares.**



6 **Count the stars.**



7 **Count the stars.**



8 **Count the circles.**

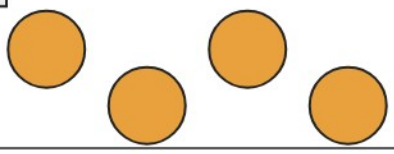

9 **Count the squares.**



10 **Count the squares.**



11 **Count the stars.**



12 **Count the stars.**



13 **Count the stars.**



14 **Count the stars.**



15 **Count the squares.**



16 **Count the squares.**



Math Practice - PreK

PM-1 Count and say numbers 1 to 5

PM-1 IELDS 6.A.ECa, 6.A.ECb, 6.A.ECd

Name: _____ Date: _____

Count the shapes. Write the number in the box.

1 **Count the squares.**

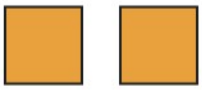

2 **Count the triangles.**



3 **Count the circles.**

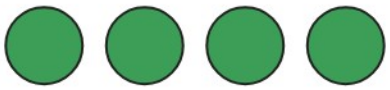

4 **Count the squares.**

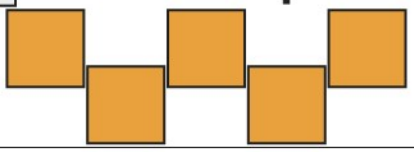

5 **Count the stars.**



6 **Count the circles.**



7 **Count the triangles.**



8 **Count the triangles.**



9 **Count the squares.**



10 **Count the triangles.**

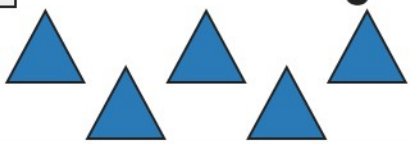

11 **Count the squares.**



12 **Count the squares.**

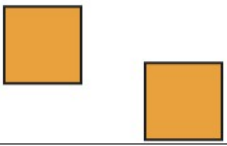

13 **Count the triangles.**



14 **Count the circles.**

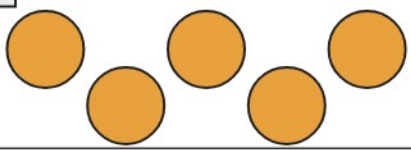

15 **Count the circles.**



16 **Count the circles.**

