Math Practice - Kindergarten

M-K8 Shapes, 2D, 3D, positions, composing

M-K8 K.G.1, K.G.2, K.G.3, K.G.4, K.G.5, K.G.6

Name: _____ Date: _____

Name the shape. Count its sides and corners.

1 What shape is this?

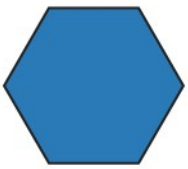

Shape: _____

2 How many sides? How many corners?



Sides: ☐

Corners: ☐

3 Is this shape flat or solid? Circle Flat or Solid.



Flat Solid

4 Where is the star? Fill in the missing word.



The star is ___ the box.

above below beside behind

5 Which two shapes make the triangle?

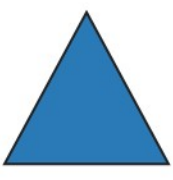

A



B

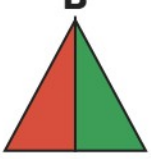

C



Math Practice - Kindergarten

M-K8 Shapes, 2D, 3D, positions, composing

M-K8 K.G.1, K.G.2, K.G.3, K.G.4, K.G.5, K.G.6

Name: _____ Date: _____

Name the shape. Count its sides and corners.

1 What shape is this?



Shape: _____

2 How many sides? How many corners?



Sides: ☐

Corners: ☐

3 Is this shape flat or solid? Circle Flat or Solid.



Flat Solid

4 Where is the star? Fill in the missing word.



The star is ___ the box.

above below beside behind

5 Which two shapes make the rectangle?



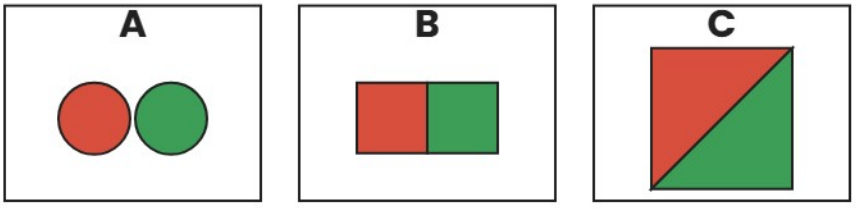

Math Practice - Kindergarten

M-K8 Shapes, 2D, 3D, positions, composing

M-K8 K.G.1, K.G.2, K.G.3, K.G.4, K.G.5, K.G.6

Name: _____ Date: _____

Name the shape. Count its sides and corners.

1 What shape is this?

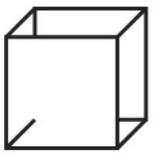

Shape: _____

2 How many sides? How many corners?



Sides: ☐

Corners: ☐

3 Is this shape flat or solid? Circle Flat or Solid.

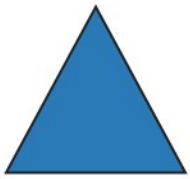

Flat Solid

4 Where is the star? Fill in the missing word.



The star is ___ the box.

above below beside behind

5 Which two shapes make the triangle?

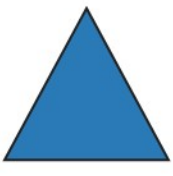

A

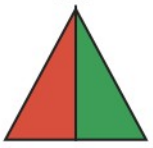

B



C

