Math Practice - Kindergarten

M-K6 Breaking numbers apart and making 10

M-K6 K.OA.3, K.OA.4

Name: _____ Date: _____

Fill in the missing number.

1 **Fill in the missing number.**

$$2 + \square = 10$$

---

2 **Fill in the missing part of the bond.**

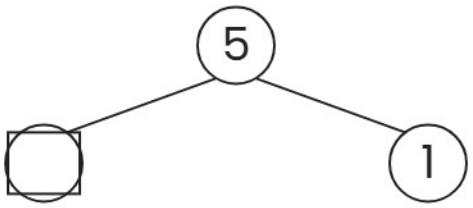

---

3 **Split the number two ways.**

Split 8 two ways:

$\square + \square = 8$ $\square + \square = 8$

---

4 **Fill in the missing number.**

$$\square + 3 = 6$$

---

5 **Fill in the missing part of the bond.**

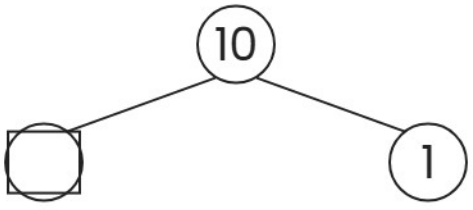

Math Practice - Kindergarten

M-K6 Breaking numbers apart and making 10

M-K6 K.OA.3, K.OA.4

Name: _____ Date: _____

Fill in the missing number.

1 **Fill in the missing number.**

$$0 + \square = 9$$

---

2 **Fill in the missing part of the bond.**

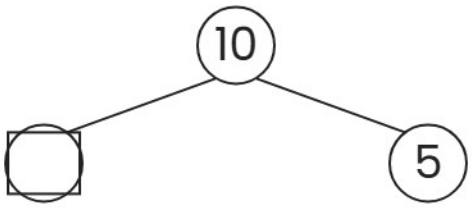

---

3 **Split the number two ways.**

Split 5 two ways:

$\square + \square = 5$ $\square + \square = 5$

---

4 **Fill in the missing number.**

$$5 + \square = 10$$

---

5 **Fill in the missing part of the bond.**

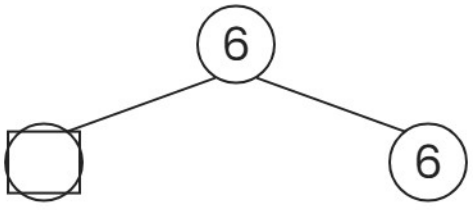

Math Practice - Kindergarten

M-K6 Breaking numbers apart and making 10

M-K6 K.OA.3, K.OA.4

Name: _____ Date: _____

Fill in the missing number.

1 **Fill in the missing number.**

$$\square + 3 = 10$$

---

2 **Fill in the missing part of the bond.**

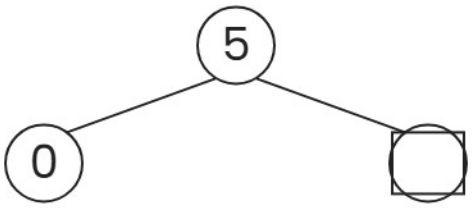

---

3 **Split the number two ways.**

Split 7 two ways:

$$\square + \square = 7 \qquad \square + \square = 7$$

---

4 **Fill in the missing number.**

$$3 + \square = 5$$

---

5 **Fill in the missing part of the bond.**

