Math Practice - Kindergarten

M-K3 Numbers 11 to 20 and counting to 100

M-K3 K.CC.1, K.CC.3, K.NBT.1

Name: _____ Date: _____

Write the missing number. Count by tens.

1 **Count all the dots. Write the number.**

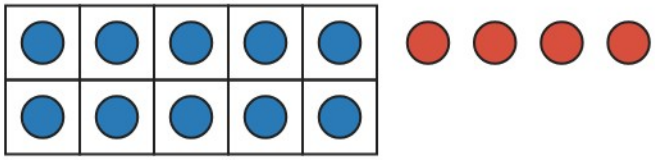

2 **Write the missing number in the box.**

10	20	30	40	50	60	70		90	100

3 **Write the missing number in the box.**

3	4	5	6	

4 **Count all the dots. Write the number.**

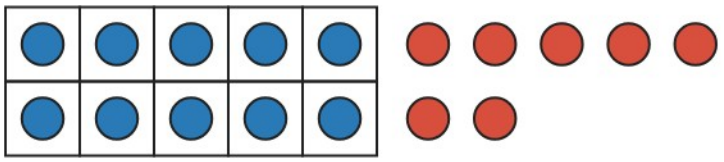

5 **Write the missing number in the box.**

10		30	40	50	60	70	80	90	100

6 **Write the missing number in the box.**

	9	10	11	12

Math Practice - Kindergarten

M-K3 Numbers 11 to 20 and counting to 100

M-K3 K.CC.1, K.CC.3, K.NBT.1

Name: _____ Date: _____

Write the missing number. Count by tens.

1 **Count all the dots. Write the number.**

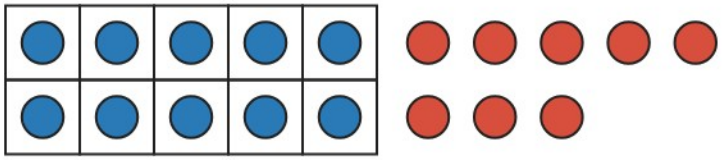

---

2 **Write the missing number in the box.**

10	20	30	40	50		70	80	90	100

---

3 **Write the missing number in the box.**

2		4	5	6

---

4 **Count all the dots. Write the number.**

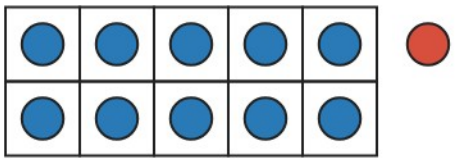

---

5 **Write the missing number in the box.**

10	20	30	40	50	60	70	80	90	

---

6 **Write the missing number in the box.**

11	12		14	15

Math Practice - Kindergarten

M-K3 Numbers 11 to 20 and counting to 100

M-K3 K.CC.1, K.CC.3, K.NBT.1

Name: _____ Date: _____

Write the missing number. Count by tens.

1 **Count all the dots. Write the number.**

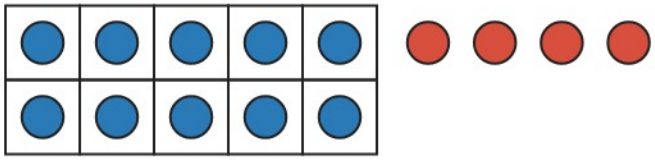

2 **Write the missing number in the box.**

10		30	40	50	60	70	80	90	100

3 **Write the missing number in the box.**

	9	10	11	12

4 **Count all the dots. Write the number.**

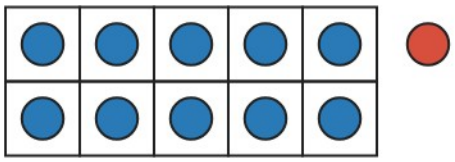

5 **Write the missing number in the box.**

10	20	30	40	50		70	80	90	100

6 **Write the missing number in the box.**

4	5	6		8