Math Practice - Grade 6

M11 Area of triangles and polygons

M11 6.G.A.1

Name: _____ Date: _____

Find the area of the triangle, the parallelogram, and the trapezoid. Split the polygon into parts and add their areas.

1 **Find the area of the triangle.**

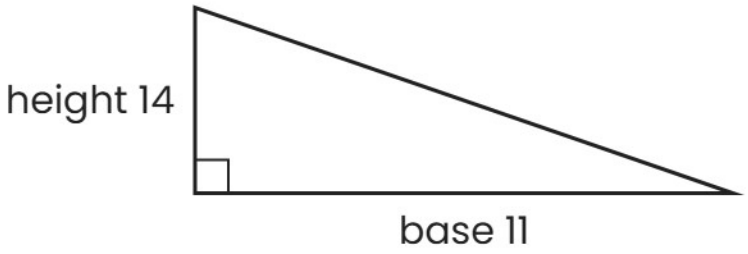

---

2 **Find the area of the parallelogram.**



---

3 **Find the area of the trapezoid.**

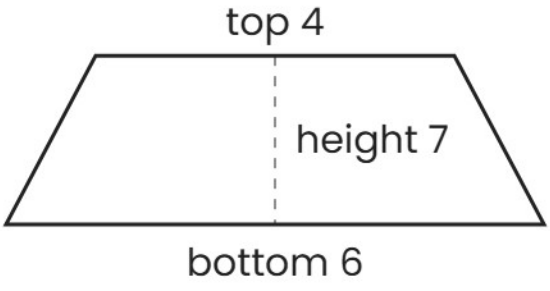

Math Practice - Grade 6

M11 Area of triangles and polygons

M11 6.G.A.1

Name: _____ Date: _____

Find the area of the triangle, the parallelogram, and the trapezoid. Split the polygon into parts and add their areas.

1 **Find the area of the triangle.**

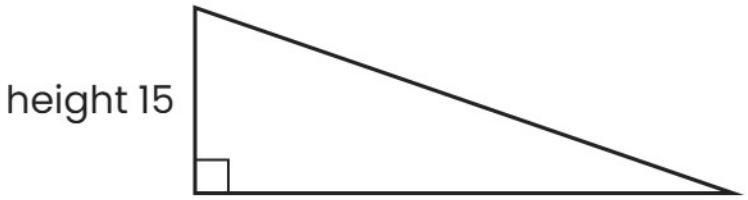

---

2 **Find the area of the parallelogram.**

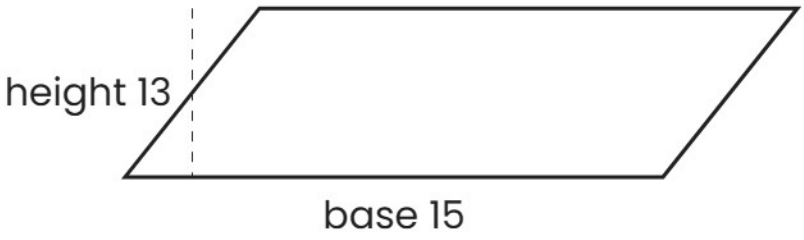

---

3 **Find the area of the trapezoid.**

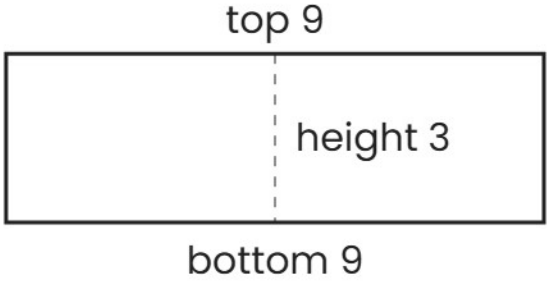

Math Practice - Grade 6

M11 Area of triangles and polygons

M11 6.G.A.1

Name: _____ Date: _____

Find the area of the triangle, the parallelogram, and the trapezoid. Split the polygon into parts and add their areas.

1 **Find the area of the triangle.**

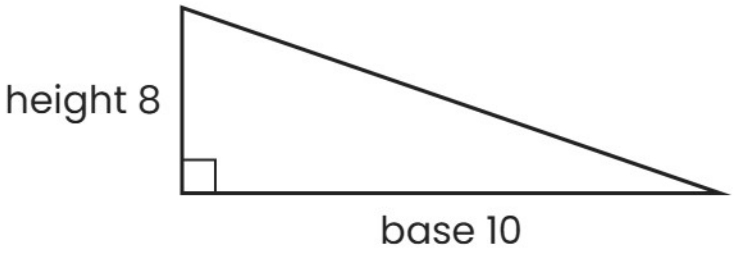

---

2 **Find the area of the parallelogram.**

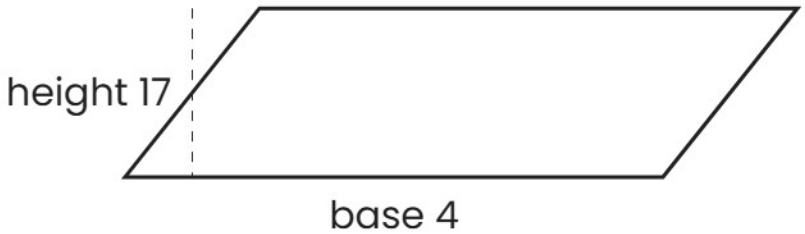

---

3 **Find the area of the trapezoid.**

