Math Practice - Grade 5

M9 Patterns and the coordinate plane

M9 5.OA.B.3, 5.G.A.1, 5.G.A.2

Name: _____ Date: _____

Write the next term in each pattern and the ordered pair they make. Plot the point on the grid. Read the coordinates of the plotted point.

1 Write the next term in each pattern, then the ordered pair they make.

A: Add 10	0	10	20	30	☐
B: Add 3	0	3	6	9	☐

Ordered pair: (☐ , ☐)

2 Plot the point (6, 10) on the grid.

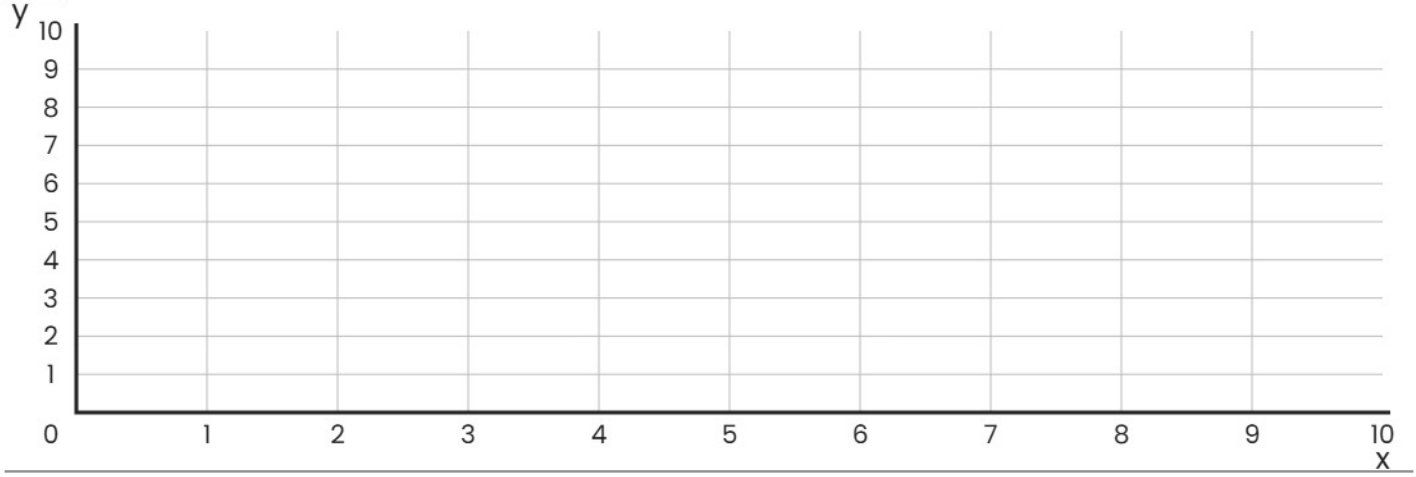

3 What are the coordinates of the plotted point? Write them in the boxes.

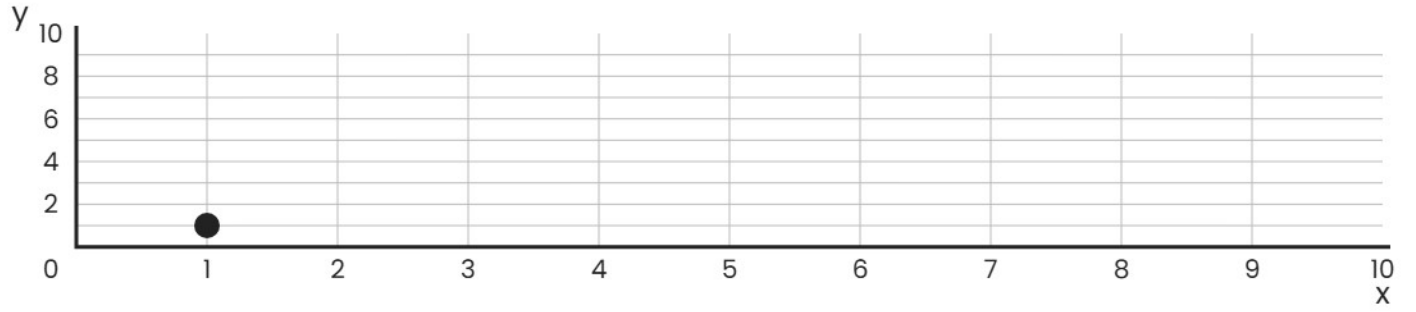

(☐ , ☐)

Math Practice - Grade 5

M9 Patterns and the coordinate plane

M9 5.OA.B.3, 5.G.A.1, 5.G.A.2

Name: _____ Date: _____

Write the next term in each pattern and the ordered pair they make. Plot the point on the grid. Read the coordinates of the plotted point.

1 Write the next term in each pattern, then the ordered pair they make.

A: Multiply by 2	2	4	8	16	☐
B: Add 10	0	10	20	30	☐

Ordered pair: (☐ , ☐)

2 Plot the point (2, 6) on the grid.

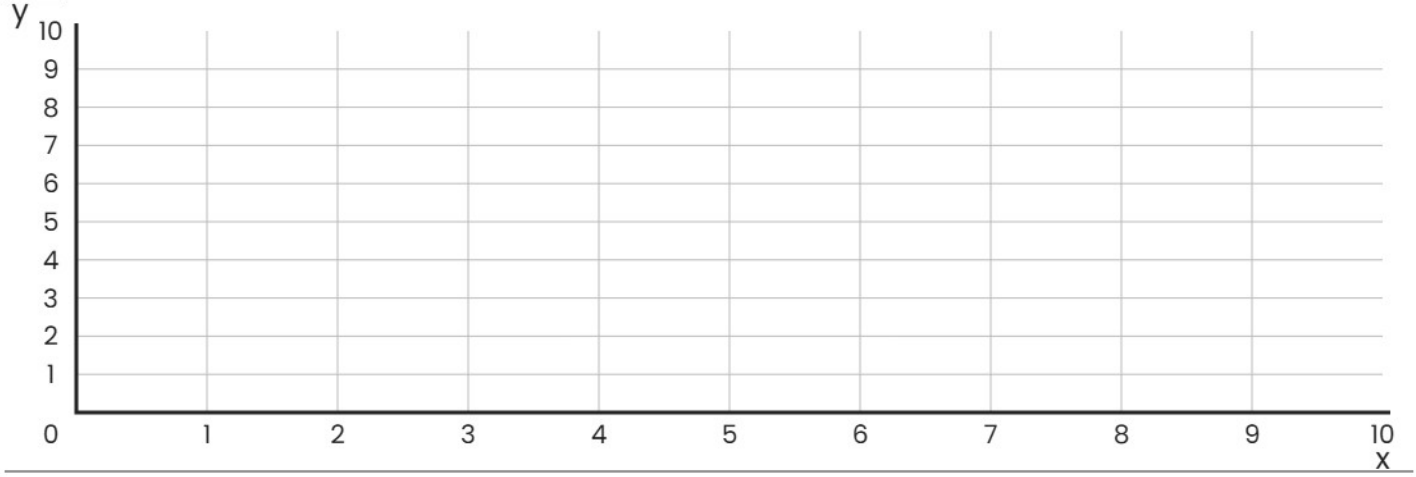

3 What are the coordinates of the plotted point? Write them in the boxes.

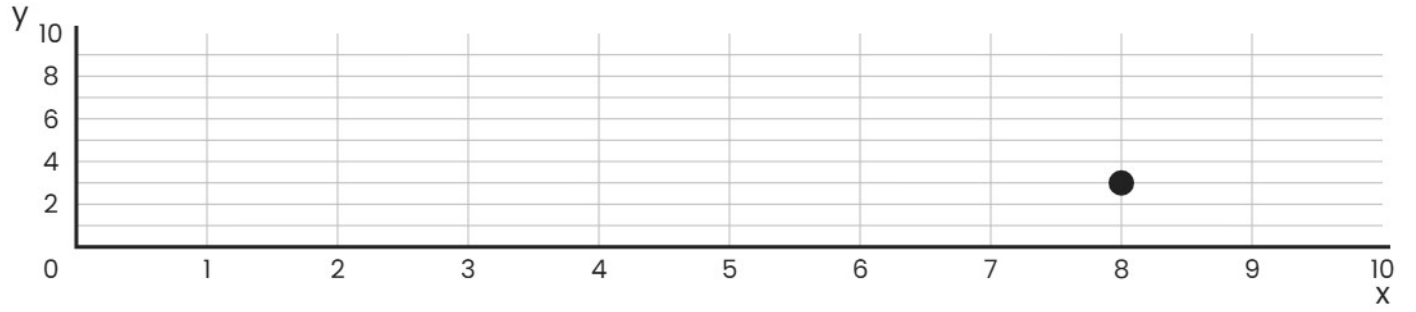

(☐ , ☐)

Math Practice - Grade 5

M9 Patterns and the coordinate plane

M9 5.OA.B.3, 5.G.A.1, 5.G.A.2

Name: _____ Date: _____

Write the next term in each pattern and the ordered pair they make. Plot the point on the grid. Read the coordinates of the plotted point.

1 Write the next term in each pattern, then the ordered pair they make.

A: Add 3	0	3	6	9	☐
B: Multiply by 2	1	2	4	8	☐

Ordered pair: (☐ , ☐)

2 Plot the point (7, 0) on the grid.

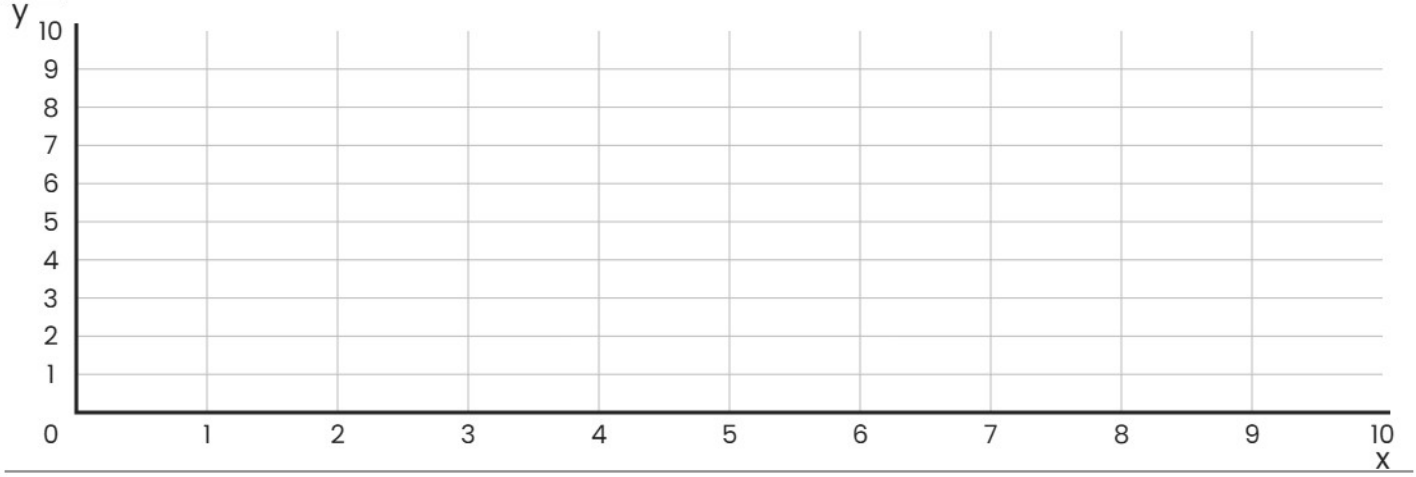

3 What are the coordinates of the plotted point? Write them in the boxes.

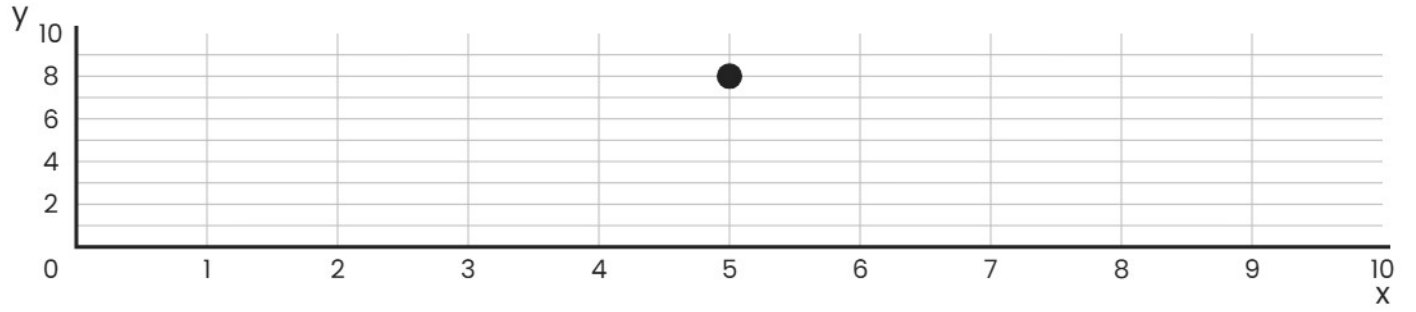

(☐ , ☐)