Math Practice - Grade 4

M6 Multi digit division with remainders

M6 4.NBT.B.6

Name: _____ Date: _____

Divide. Write the quotient and the remainder. Check your answer.

1 **Divide. Write the quotient and the remainder.**

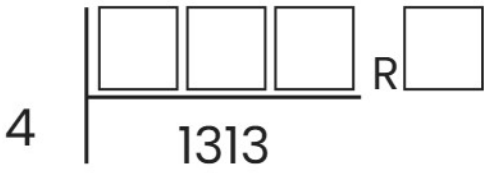

---

2 **Divide. The divisor goes in evenly.**

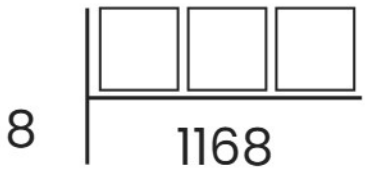

---

3 **Divide. Then check: multiply the quotient by the divisor and add the remainder.**

5179 / 9 = ☐ R ☐

Check: 575 x 9 + 4 = ☐

---

4 **Divide. Write the quotient and the remainder.**

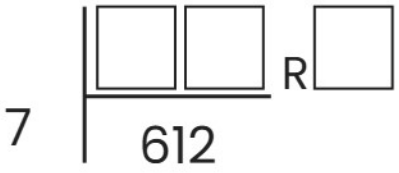

Math Practice - Grade 4

M6 Multi digit division with remainders

M6 4.NBT.B.6

Name: _____ Date: _____

Divide. Write the quotient and the remainder. Check your answer.

1 Divide. Write the quotient and the remainder.

$$4 \overline{)2653} \quad \square\square\square \text{ R } \square$$

2 Divide. The divisor goes in evenly.

$$5 \overline{)730} \quad \square\square\square$$

3 Divide. Then check: multiply the quotient by the divisor and add the remainder.

238 / 3 = ☐ R ☐

Check: 79 x 3 + 1 = ☐

4 Divide. Write the quotient and the remainder.

$$2 \overline{)203} \quad \square\square\square \text{ R } \square$$

Math Practice - Grade 4

M6 Multi digit division with remainders

M6 4.NBT.B.6

Name: _____ Date: _____

Divide. Write the quotient and the remainder. Check your answer.

1 **Divide. Write the quotient and the remainder.**



---

2 **Divide. The divisor goes in evenly.**

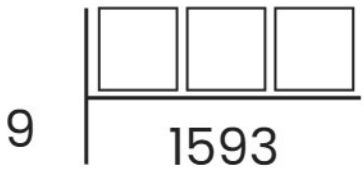

---

3 **Divide. Then check: multiply the quotient by the divisor and add the remainder.**

1580 / 3 = ☐ R ☐

Check: 526 x 3 + 2 = ☐

---

4 **Divide. Write the quotient and the remainder.**

