Math Practice - Grade 4

M13 Angles and geometry

M13 4.MD.C.5, 4.MD.C.5a, 4.MD.C.5b, 4.MD.C.6, 4.MD.C.7, 4.G.A.1, 4.G.A.2, 4.G.A.3

Name: _____ Date: _____

Name the angle. Measure the angle. Find the unknown angle. Name the lines and the shape.

1 **Circle the name of the angle.**

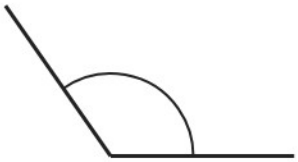

Acute | Right | Obtuse | Straight

---

2 **How many degrees is the angle?**



Angle = ☐ degrees

---

3 **Use the protractor to measure the angle.**

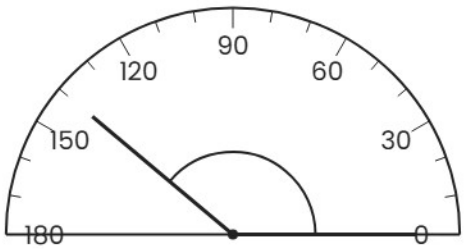

Angle = ☐ degrees

---

4 **The whole angle is 65 degrees. One part is 60 degrees. How many degrees is the other part?**

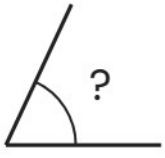

Other part = ☐ degrees

Math Practice - Grade 4

M13 Angles and geometry

M13 4.MD.C.5, 4.MD.C.5a, 4.MD.C.5b, 4.MD.C.6, 4.MD.C.7, 4.G.A.1, 4.G.A.2, 4.G.A.3

Name: _____ Date: _____

Name the angle. Measure the angle. Find the unknown angle. Name the lines and the shape.

1 **Circle the name of the angle.**

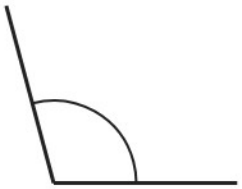

Acute | Right | Obtuse | Straight

---

2 **How many degrees is the angle?**

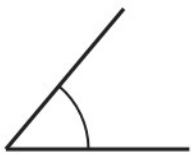

Angle = ☐ degrees

---

3 **Use the protractor to measure the angle.**

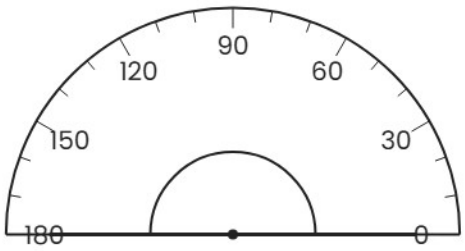

Angle = ☐ degrees

---

4 **The whole angle is 65 degrees. One part is 15 degrees. How many degrees is the other part?**

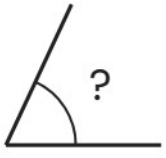

Other part = ☐ degrees

Math Practice - Grade 4

M13 Angles and geometry

M13 4.MD.C.5, 4.MD.C.5a, 4.MD.C.5b, 4.MD.C.6, 4.MD.C.7, 4.G.A.1, 4.G.A.2, 4.G.A.3

Name: _____ Date: _____

Name the angle. Measure the angle. Find the unknown angle. Name the lines and the shape.

1 **Circle the name of the angle.**



Acute | Right | Obtuse | Straight

---

2 **How many degrees is the angle?**

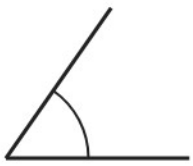

Angle = ☐ degrees

---

3 **Use the protractor to measure the angle.**

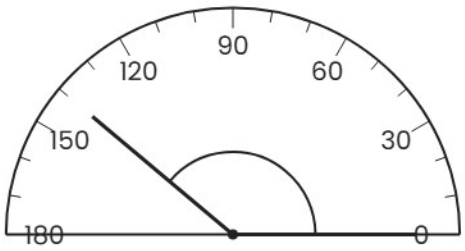

Angle = ☐ degrees

---

4 **The whole angle is 100 degrees. One part is 30 degrees. How many degrees is the other part?**

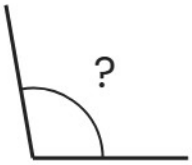

Other part = ☐ degrees