Math Practice - Grade 4

M12 Area, perimeter, and line plots

M12 4.MD.A.3, 4.MD.B.4

Name: _____ Date: _____

Find the area and the perimeter. Find the missing side. Read the line plot.

1 **Find the area of the rectangle.**

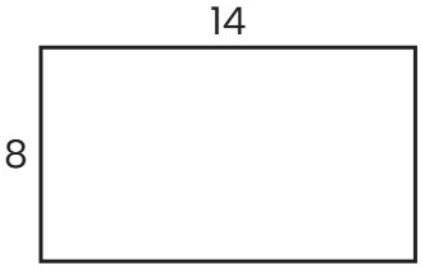

Area = ☐ square units

---

2 **Find the perimeter of the rectangle.**

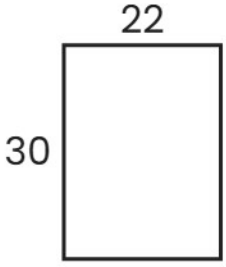

Perimeter = ☐ units

---

3 **The area of the rectangle is 120 square units. Find the missing side.**

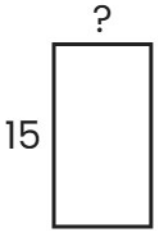

Area = 120 sq units

Length = ☐

---

4 **How many measurements are shown in all?**

Length (inches)

Answer: ☐

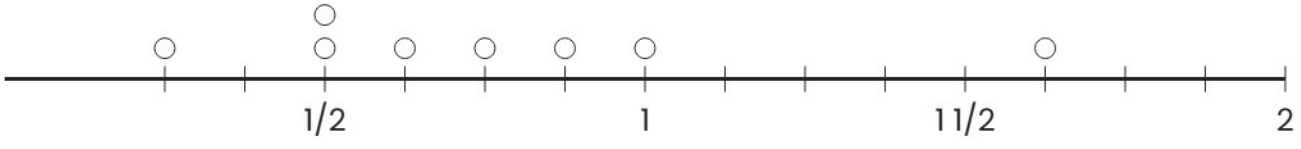

Math Practice - Grade 4

M12 Area, perimeter, and line plots

M12 4.MD.A.3, 4.MD.B.4

Name: _____ Date: _____

Find the area and the perimeter. Find the missing side. Read the line plot.

1 **Find the area of the rectangle.**

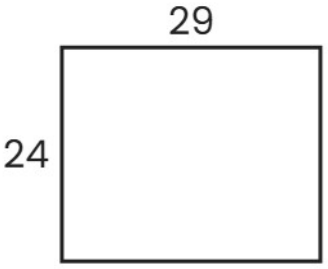

Area = ☐ square units

---

2 **Find the perimeter of the rectangle.**

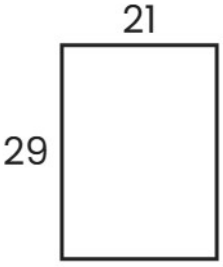

Perimeter = ☐ units

---

3 **The area of the rectangle is 609 square units. Find the missing side.**

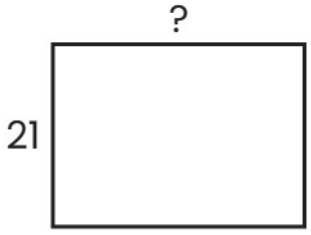

Area = 609 sq units

Length = ☐

---

4 **How many measurements are 3/4?**

Length (inches)

Answer: ☐

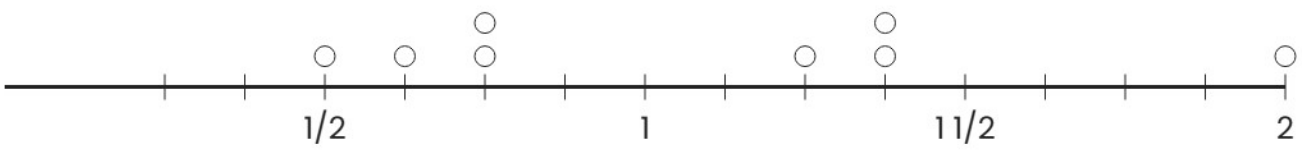

Math Practice - Grade 4

M12 Area, perimeter, and line plots

M12 4.MD.A.3, 4.MD.B.4

Name: _____ Date: _____

Find the area and the perimeter. Find the missing side. Read the line plot.

1 **Find the area of the rectangle.**

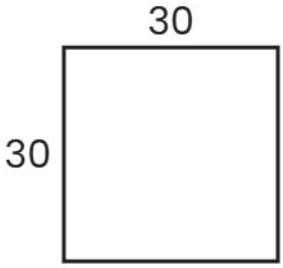

Area = ☐ square units

---

2 **Find the perimeter of the rectangle.**

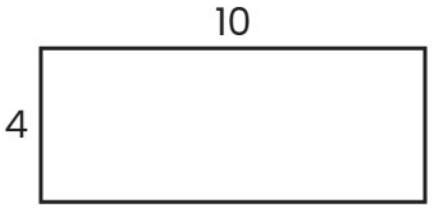

Perimeter = ☐ units

---

3 **The area of the rectangle is 319 square units. Find the missing side.**

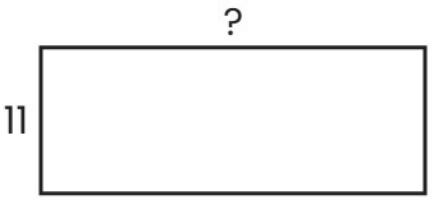

Area = 319 sq units

Length = ☐

---

4 **How many measurements are shown in all?**

Length (inches)

Answer: ☐

