Math Practice - Grade 3

M4 Division as sharing and grouping

M4 3.OA.A.2, 3.OA.A.4, 3.OA.B.6

Name: _____ Date: _____

Share equally. Write the division equation.

1 **Owen shares 12 toy cars equally among 4 plates. How many toy cars are on each plate?**



12 / 4 = ☐

---

2 **Find the missing number.**

9 x ☐ = 45

---

3 **Write the multiplication that goes with 24 / 4.**

24 / 4 = ☐

4 x ☐ = 24

---

4 **Ben shares 8 balloons equally among 2 plates. How many balloons are on each plate?**



8 / 2 = ☐

Math Practice - Grade 3

M4 Division as sharing and grouping

M4 3.OA.A.2, 3.OA.A.4, 3.OA.B.6

Name: _____ Date: _____

Share equally. Write the division equation.

1 **Ben shares 35 stickers equally among 7 plates. How many stickers are on each plate?**



35 / 7 = ☐

---

2 **Find the missing number.**

9 x ☐ = 27

---

3 **Write the multiplication that goes with 45 / 5.**

45 / 5 = ☐

5 x ☐ = 45

---

4 **Mia shares 48 crayons equally among 8 plates. How many crayons are on each plate?**

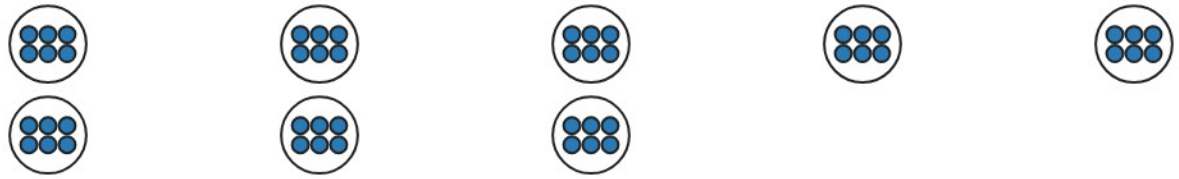

48 / 8 = ☐

Math Practice - Grade 3

M4 Division as sharing and grouping

M4 3.OA.A.2, 3.OA.A.4, 3.OA.B.6

Name: _____ Date: _____

Share equally. Write the division equation.

1 **Zoe shares 49 pencils equally among 7 plates. How many pencils are on each plate?**



49 / 7 = ☐

---

2 **Find the missing number.**

4 x ☐ = 16

---

3 **Write the multiplication that goes with 20 / 10.**

20 / 10 = ☐

10 x ☐ = 20

---

4 **Lily shares 27 marbles equally among 3 plates. How many marbles are on each plate?**



27 / 3 = ☐