Math Practice - Grade 3

M3 Multiplication as equal groups and arrays

M3 3.OA.A.1, 3.OA.A.3

Name: _____ Date: _____

Count the groups. Write the multiplication equation.

1 **How many groups? How many in each group? Write the multiplication.**



10 x 6 = ☐

---

2 **How many rows? How many columns? Write the multiplication.**



6 x 9 = ☐

---

3 **Ella has 7 bags with 2 marbles in each bag. How many marbles does Ella have in all?**

7 x 2 = ☐

---

4 **How many groups? How many in each group? Write the multiplication.**



6 x 3 = ☐

Math Practice - Grade 3

M3 Multiplication as equal groups and arrays

M3 3.OA.A.1, 3.OA.A.3

Name: _____ Date: _____

Count the groups. Write the multiplication equation.

1 **How many groups? How many in each group? Write the multiplication.**



3 x 5 = ☐

---

2 **How many rows? How many columns? Write the multiplication.**



2 x 5 = ☐

---

3 **Ella has 6 bags with 9 buttons in each bag. How many buttons does Ella have in all?**

6 x 9 = ☐

---

4 **How many groups? How many in each group? Write the multiplication.**



4 x 2 = ☐

Math Practice - Grade 3

M3 Multiplication as equal groups and arrays

M3 3.OA.A.1, 3.OA.A.3

Name: _____ Date: _____

Count the groups. Write the multiplication equation.

1 **How many groups? How many in each group? Write the multiplication.**



4 x 2 = ☐

---

2 **How many rows? How many columns? Write the multiplication.**



6 x 8 = ☐

---

3 **Jack has 7 packs with 7 toy cars in each pack. How many toy cars does Jack have in all?**

7 x 7 = ☐

---

4 **How many groups? How many in each group? Write the multiplication.**



7 x 6 = ☐