Math Practice - Grade 3

M13 Shapes and equal shares

M13 3.G.A.1, 3.G.A.2

Name: _____ Date: _____

Name the shape. Count the sides. Shade one share.

1 **How many sides? How many angles?**



Sides: ☐

Angles: ☐

---

2 **Name this quadrilateral.**



Name: ☐

---

3 **Each part is what fraction of the whole?**



One part is ☐/☐

---

4 **How many sides? How many angles?**



Sides: ☐

Angles: ☐

Math Practice - Grade 3

M13 Shapes and equal shares

M13 3.G.A.1, 3.G.A.2

Name: _____ Date: _____

Name the shape. Count the sides. Shade one share.

1 **How many sides? How many angles?**

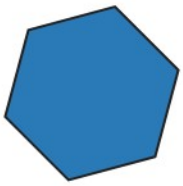

Sides: ☐

Angles: ☐

---

2 **Name this quadrilateral.**



Name: ☐

---

3 **Each part is what fraction of the whole?**



One part is ☐/☐

---

4 **How many sides? How many angles?**



Sides: ☐

Angles: ☐

Math Practice - Grade 3

M13 Shapes and equal shares

M13 3.G.A.1, 3.G.A.2

Name: _____ Date: _____

Name the shape. Count the sides. Shade one share.

1 **Is this shape a quadrilateral? Circle Yes or No.**



Yes No

---

2 **Name this quadrilateral.**



Name: ☐

---

3 **Each part is what fraction of the whole?**

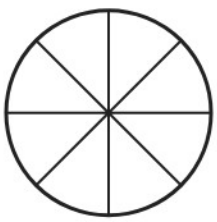

One part is ☐

---

4 **Is this shape a quadrilateral? Circle Yes or No.**



Yes No