Math Practice - Grade 3

M12 Perimeter, and area versus perimeter

M12 3.MD.D.8

Name: _____ Date: _____

Add the sides to find the perimeter. Compare the areas.

1 **Add the side lengths to find the perimeter.**

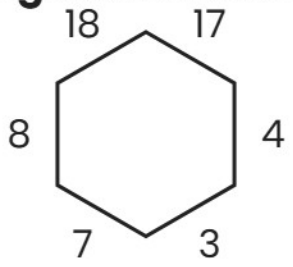

Perimeter: ☐

---

2 **The perimeter is 40. Find the missing side.**

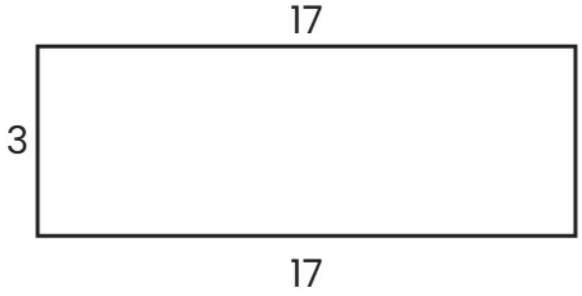

Missing side: ☐

---

3 **Both rectangles have the same perimeter. Which one has the bigger area? Write A or B.**



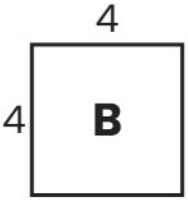

Answer: ☐

---

4 **Add the side lengths to find the perimeter.**

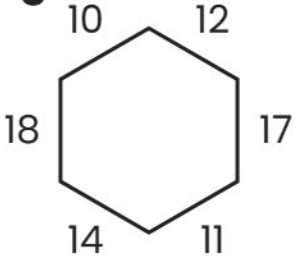

Perimeter: ☐

Math Practice - Grade 3

M12 Perimeter, and area versus perimeter

M12 3.MD.D.8

Name: _____ Date: _____

Add the sides to find the perimeter. Compare the areas.

1 **Add the side lengths to find the perimeter.**

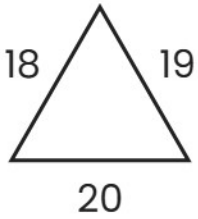

Perimeter: ☐

---

2 **The perimeter is 64. Find the missing side.**

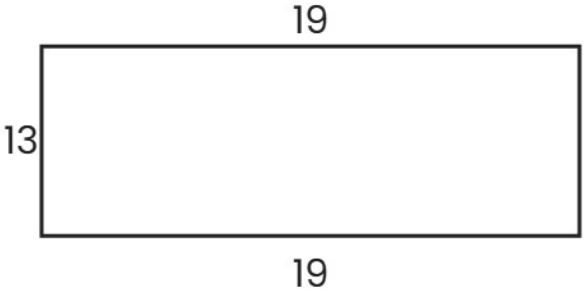

Missing side: ☐

---

3 **Both rectangles have the same area. Which one has the bigger perimeter? Write A or B.**

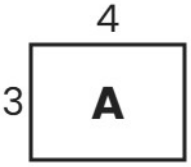

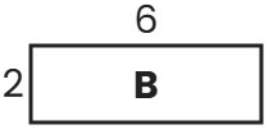

Answer: ☐

---

4 **Add the side lengths to find the perimeter.**

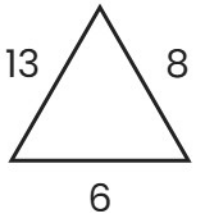

Perimeter: ☐

Math Practice - Grade 3

M12 Perimeter, and area versus perimeter

M12 3.MD.D.8

Name: _____ Date: _____

Add the sides to find the perimeter. Compare the areas.

1 **Add the side lengths to find the perimeter.**

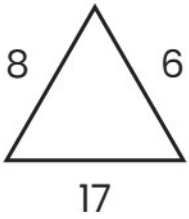

Perimeter: ☐

---

2 **The perimeter is 24. Find the missing side.**

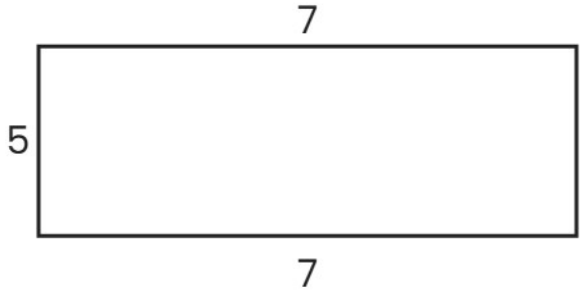

Missing side: ☐

---

3 **Both rectangles have the same area. Which one has the bigger perimeter? Write A or B.**

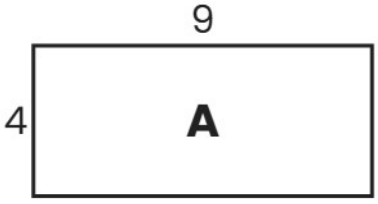

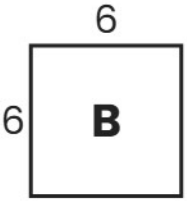

Answer: ☐

---

4 **Add the side lengths to find the perimeter.**

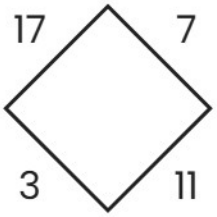

Perimeter: ☐