Math Practice - Grade 3

M11 Area

M11 3.MD.C.5, 3.MD.C.5a, 3.MD.C.5b, 3.MD.C.6, 3.MD.C.7, 3.MD.C.7a, 3.MD.C.7b, 3.MD.C.7c, 3.MD.C.7d

Name: _____ Date: _____

Count the squares. Multiply the sides. Add the parts.

1 **How many unit squares cover the rectangle?**



Squares: ☐

---

2 **The rectangle is 9 long and 9 wide. What is its area?**

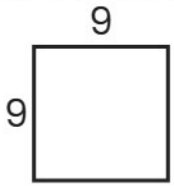

9 x 9 = ☐

---

3 **Split the shape into two rectangles. Add their areas.**



Top: ☐

Bottom: ☐

Total: ☐

---

4 **How many unit squares cover the rectangle?**



Squares: ☐

Math Practice - Grade 3

M11 Area

M11 3.MD.C.5, 3.MD.C.5a, 3.MD.C.5b, 3.MD.C.6, 3.MD.C.7, 3.MD.C.7a, 3.MD.C.7b, 3.MD.C.7c, 3.MD.C.7d

Name: _____ Date: _____

Count the squares. Multiply the sides. Add the parts.

1 **How many unit squares cover the rectangle?**



Squares: ☐

---

2 **The rectangle is 3 long and 4 wide. What is its area?**

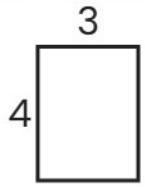

3 x 4 = ☐

---

3 **Split the shape into two rectangles. Add their areas.**

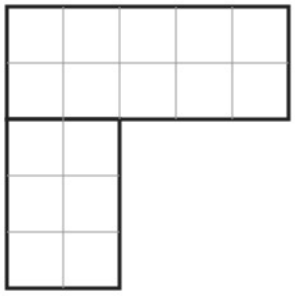

Top: ☐

Bottom: ☐

Total: ☐

---

4 **How many unit squares cover the rectangle?**

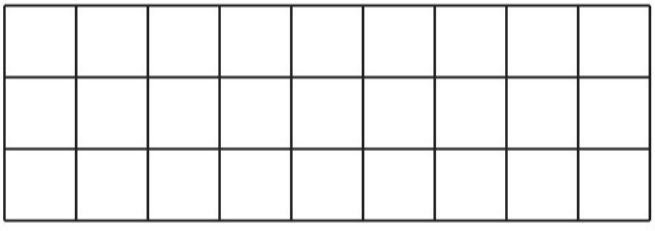

Squares: ☐

Math Practice - Grade 3

M11 Area

M11 3.MD.C.5, 3.MD.C.5a, 3.MD.C.5b, 3.MD.C.6, 3.MD.C.7, 3.MD.C.7a, 3.MD.C.7b, 3.MD.C.7c, 3.MD.C.7d

Name: _____ Date: _____

Count the squares. Multiply the sides. Add the parts.

1 **How many unit squares cover the rectangle?**

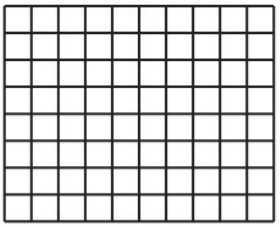

Squares: ☐

---

2 **The rectangle is 8 long and 7 wide. What is its area?**

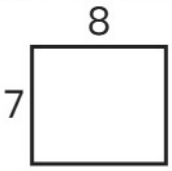

8 x 7 = ☐

---

3 **Split the shape into two rectangles. Add their areas.**



Top: ☐

Bottom: ☐

Total: ☐

---

4 **How many unit squares cover the rectangle?**



Squares: ☐