Math Practice - Grade 2

M9 Money

M9 2.MD.C.8

Name: _____ Date: _____

Count the coins. Make change.

1 **How much is it in all? Write the total.**

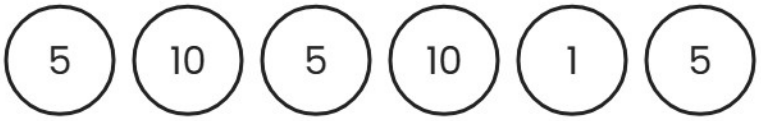

Total: ☐

---

2 **You pay 100¢. The price is 84¢. How much change do you get?**

100¢ - 84¢ = ☐

---

3 **Liam has 2 bills of $20 and 3 coins of $5. How much does Liam have in all?**



$40 + $15 = ☐

---

4 **How much is it in all? Write the total.**



Total: ☐

Math Practice - Grade 2

M9 Money

M9 2.MD.C.8

Name: _____ Date: _____

Count the coins. Make change.

1 **How much is it in all? Write the total.**



Total: ☐

---

2 **You pay 100¢. The price is 71¢. How much change do you get?**

100¢ - 71¢ = ☐

---

3 **Mia has 2 bills of $20 and 3 coins of $5. How much does Mia have in all?**



$40 + $15 = ☐

---

4 **How much is it in all? Write the total.**

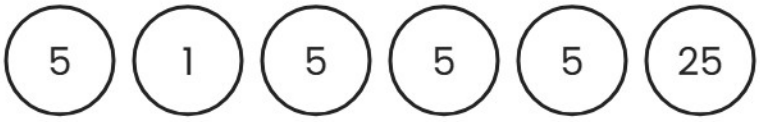

Total: ☐

Math Practice - Grade 2

M9 Money

M9 2.MD.C.8

Name: _____ Date: _____

Count the coins. Make change.

1 **How much is it in all? Write the total.**

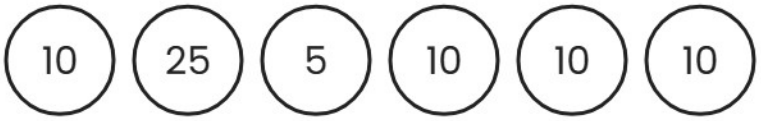

Total: ☐

---

2 **You pay 100¢. The price is 38¢. How much change do you get?**

100¢ - 38¢ = ☐

---

3 **Ruby has $59. Ruby buys a ball for $11. How much does Ruby have left?**

$59 - $11 = ☐

---

4 **How much is it in all? Write the total.**

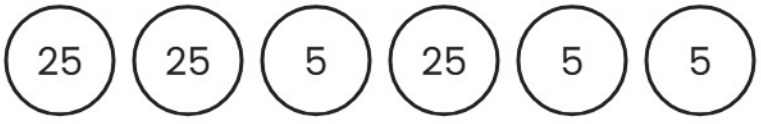

Total: ☐