Math Practice - Grade 2

M7 Measuring length and the number line

M7 2.MD.A.1, 2.MD.A.2, 2.MD.A.3, 2.MD.A.4, 2.MD.B.5, 2.MD.B.6

Name: _____ Date: _____

Measure the length. Read the number line.

1 **How long is the bar? Write the length in inches.**



Length: ☐

---

2 **Guess the length first, then measure it.**

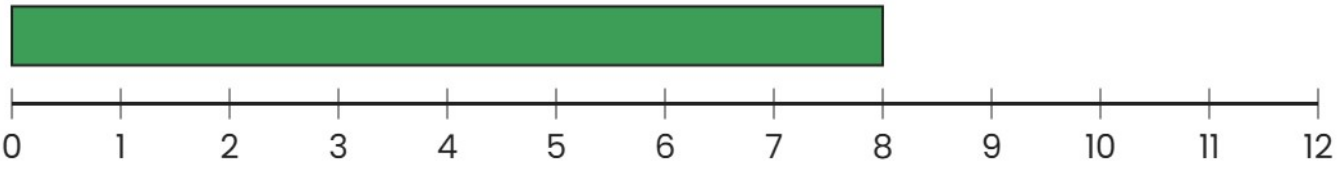

Estimate: ☐ Measure: ☐

---

3 **How much longer is the red bar than the blue bar?**

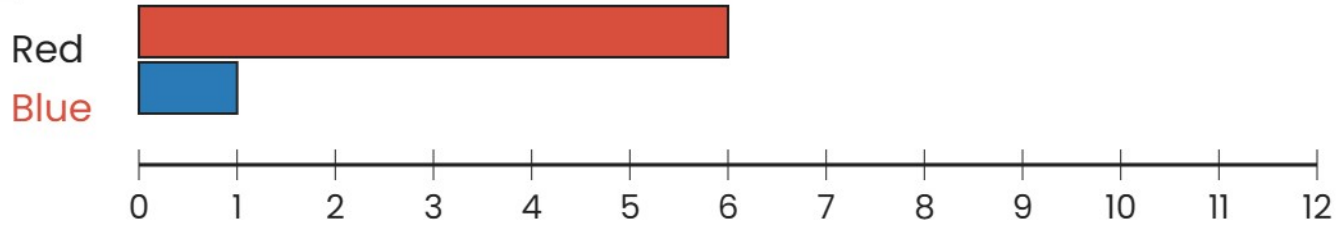

Longer by: ☐

---

4 **Follow the jumps. Write the landing number.**

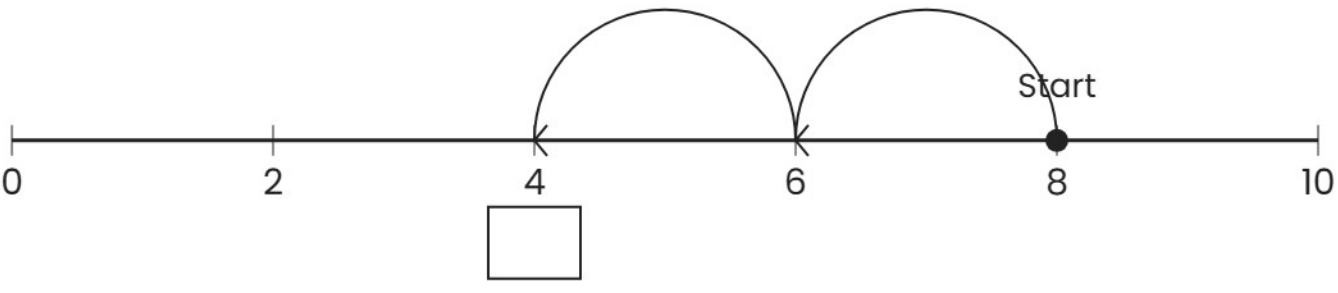

☐

Math Practice - Grade 2

M7 Measuring length and the number line

M7 2.MD.A.1, 2.MD.A.2, 2.MD.A.3, 2.MD.A.4, 2.MD.B.5, 2.MD.B.6

Name: _____ Date: _____

Measure the length. Read the number line.

1 **How long is the bar? Write the length in inches.**

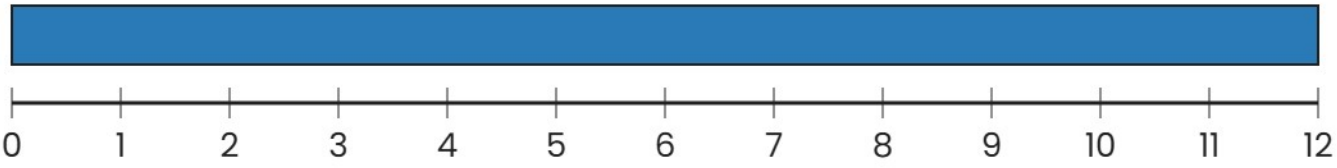

Length: ☐

---

2 **Guess the length first, then measure it.**

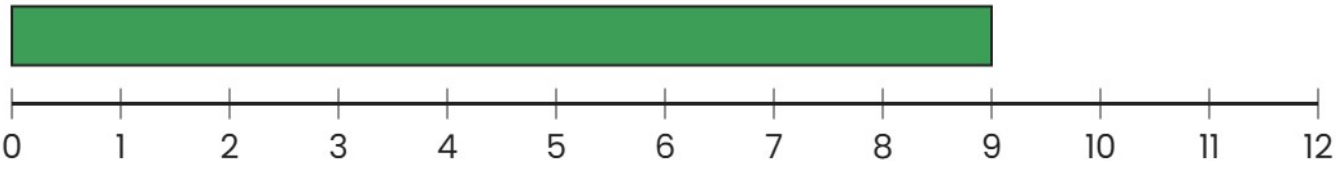

Estimate: ☐ Measure: ☐

---

3 **How much longer is the red bar than the blue bar?**

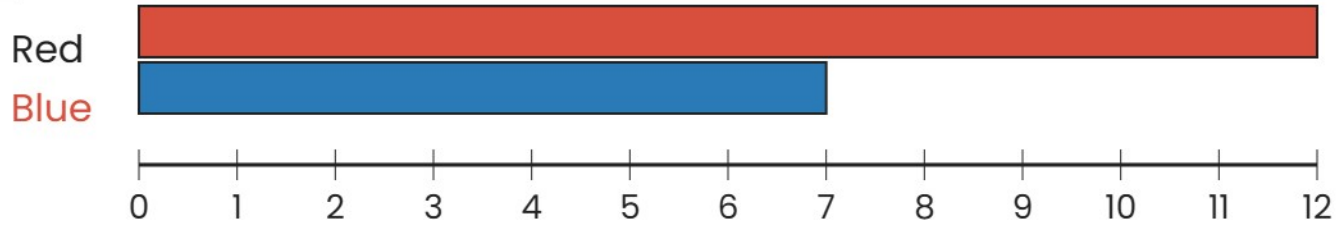

Longer by: ☐

---

4 **Follow the jumps. Write the landing number.**

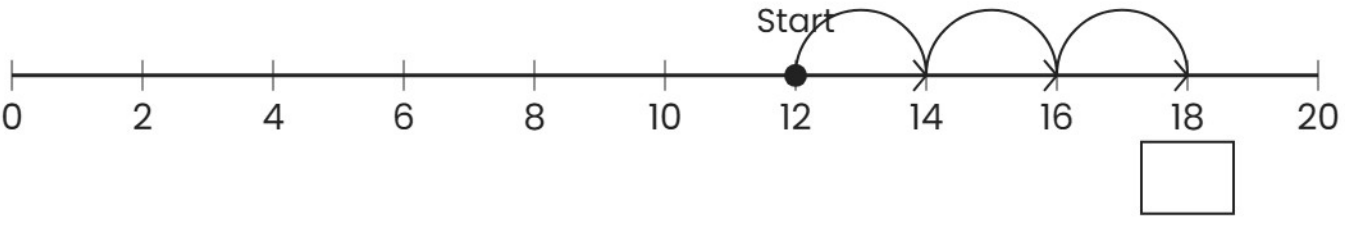

☐

Math Practice - Grade 2

M7 Measuring length and the number line

M7 2.MD.A.1, 2.MD.A.2, 2.MD.A.3, 2.MD.A.4, 2.MD.B.5, 2.MD.B.6

Name: _____ Date: _____

Measure the length. Read the number line.

1 **How long is the bar? Write the length in inches.**

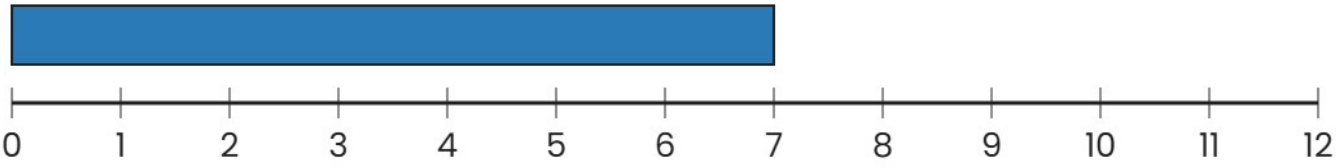

Length: ☐

---

2 **Guess the length first, then measure it.**

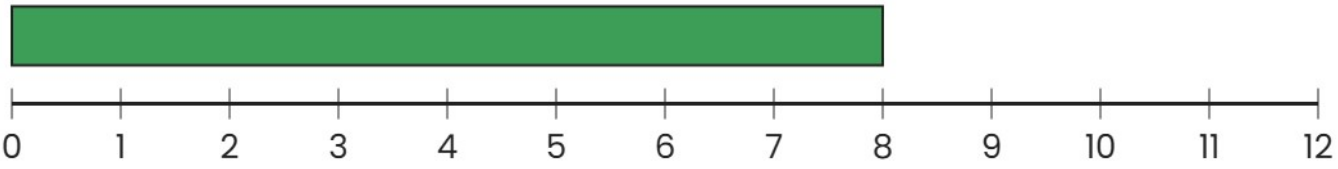

Estimate: ☐ Measure: ☐

---

3 **How much longer is the red bar than the blue bar?**

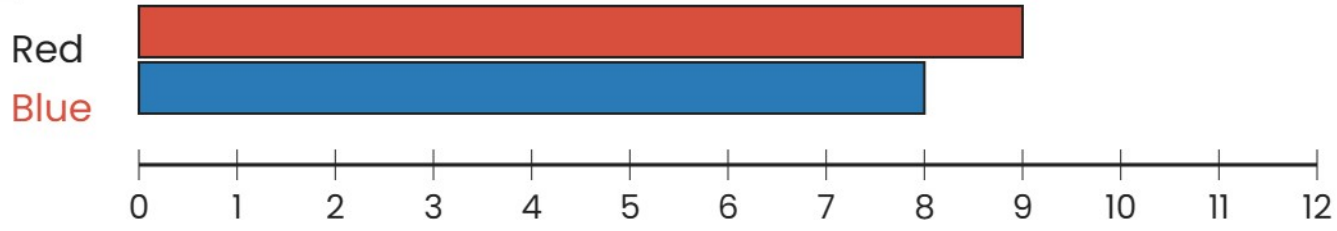

Longer by: ☐

---

4 **Follow the jumps. Write the landing number.**

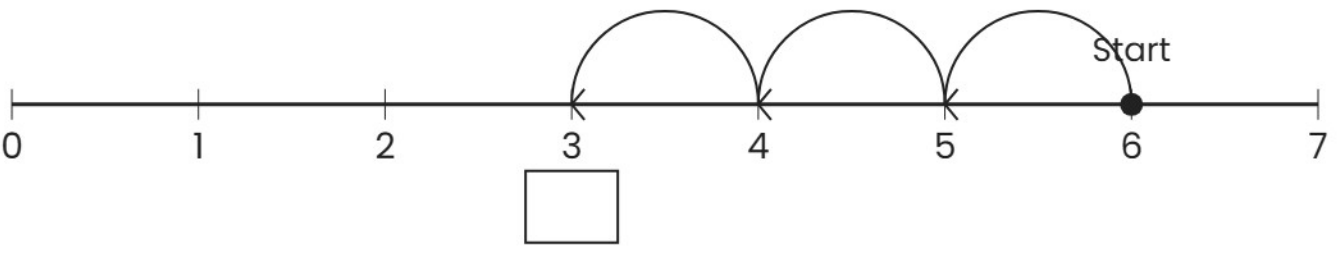

☐