Math Practice - Grade 2

M6 Odd and even, arrays, equal groups

M6 2.OA.C.3, 2.OA.C.4

Name: _____ Date: _____

Is it odd or even? Draw the array and write the repeated addition.

1 **Pair the dots. Circle Odd or Even.**



Odd Even

2 **Draw an array with 2 rows and 4 columns.**

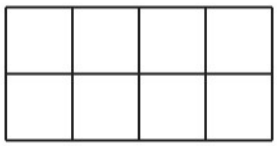

4 + 4 = ☐

3 **Pair the dots. Circle Odd or Even.**



Odd Even

4 **Draw an array with 5 rows and 5 columns.**

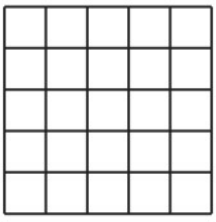

5 + 5 + 5 + 5 + 5 = ☐

Math Practice - Grade 2

M6 Odd and even, arrays, equal groups

M6 2.OA.C.3, 2.OA.C.4

Name: _____ Date: _____

Is it odd or even? Draw the array and write the repeated addition.

1 **Pair the dots. Circle Odd or Even.**



Odd Even

2 **Draw an array with 5 rows and 2 columns.**



2 + 2 + 2 + 2 + 2 = ☐

3 **Pair the dots. Circle Odd or Even.**



Odd Even

4 **Draw an array with 4 rows and 2 columns.**

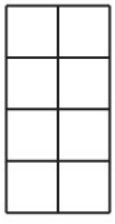

2 + 2 + 2 + 2 = ☐

Math Practice - Grade 2

M6 Odd and even, arrays, equal groups

M6 2.OA.C.3, 2.OA.C.4

Name: _____ Date: _____

Is it odd or even? Draw the array and write the repeated addition.

1 **Pair the dots. Circle Odd or Even.**



Odd Even

2 **Draw an array with 4 rows and 4 columns.**

4 + 4 + 4 + 4 = ☐

3 **Pair the dots. Circle Odd or Even.**



Odd Even

4 **Draw an array with 5 rows and 4 columns.**

4 + 4 + 4 + 4 + 4 = ☐