Math Practice - Grade 2

M3 Place value to 1000, skip counting, expanded form

M3 2.NBT.A.1, 2.NBT.A.1a, 2.NBT.A.1b, 2.NBT.A.2, 2.NBT.A.3, 2.NBT.A.4

Name: _____ Date: _____

How many hundreds? How many tens? How many ones? Compare the numbers.

1 **How many hundreds? How many tens? How many ones?**

Hundreds: 

Tens: 

Ones: 

---

2 **Write 268 in expanded form.**

268 = ☐ + ☐ + ☐

---

3 **Fill in the missing number.**

370 , 380 , 390 , 400 , ☐

---

4 **Write > or < or = in the box.**

675 ☐ 675

Math Practice - Grade 2

M3 Place value to 1000, skip counting, expanded form

M3 2.NBT.A.1, 2.NBT.A.1a, 2.NBT.A.1b, 2.NBT.A.2, 2.NBT.A.3, 2.NBT.A.4

Name: _____ Date: _____

How many hundreds? How many tens? How many ones? Compare the numbers.

1 **How many hundreds? How many tens? How many ones?**

Hundreds: 

Tens: 

Ones: 

---

2 **Write 796 in expanded form.**

796 = ☐ + ☐ + ☐

---

3 **Fill in the missing number.**

510 , 520 , 530 , ☐ , 550

---

4 **Write > or < or = in the box.**

987 ☐ 292

Math Practice - Grade 2

M3 Place value to 1000, skip counting, expanded form

M3 2.NBT.A.1, 2.NBT.A.1a, 2.NBT.A.1b, 2.NBT.A.2, 2.NBT.A.3, 2.NBT.A.4

Name: _____ Date: _____

How many hundreds? How many tens? How many ones? Compare the numbers.

1 **How many hundreds? How many tens? How many ones?**

Hundreds:  ☐

Tens:  ☐

Ones: ☐

---

2 **Write 589 in expanded form.**

589 = ☐ + ☐ + ☐

---

3 **Fill in the missing number.**

580 , 585 , ☐ , 595 , 600

---

4 **Write > or < or = in the box.**

173 ☐ 173