Math Practice - Grade 2

M11 Shapes, halves, thirds, fourths

M11 2.G.A.1, 2.G.A.2, 2.G.A.3

Name: _____ Date: _____

Name the shape. Count the squares. Shade one share.

1 **Name this shape. How many sides? How many angles?**



Shape: _____

Sides: ☐

Angles: ☐

---

2 **The rectangle has 5 rows and 5 columns of squares. How many squares in all?**

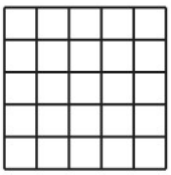

Squares: ☐

---

3 **Shade one third.**



One share is a ☐

---

4 **Name this shape. How many sides? How many angles?**



Shape: _____

Sides: ☐

Angles: ☐

Math Practice - Grade 2

M11 Shapes, halves, thirds, fourths

M11 2.G.A.1, 2.G.A.2, 2.G.A.3

Name: _____ Date: _____

Name the shape. Count the squares. Shade one share.

1 **Name this shape. How many sides? How many angles?**



Shape: _____

Sides: ☐

Angles: ☐

---

2 **The rectangle has 3 rows and 4 columns of squares. How many squares in all?**

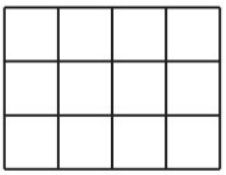

Squares: ☐

---

3 **Shade one half.**

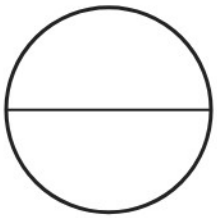

One share is a ☐

---

4 **Name this shape. How many sides? How many angles?**

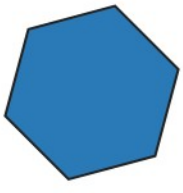

Shape: _____

Sides: ☐

Angles: ☐

Math Practice - Grade 2

M11 Shapes, halves, thirds, fourths

M11 2.G.A.1, 2.G.A.2, 2.G.A.3

Name: _____ Date: _____

Name the shape. Count the squares. Shade one share.

1 **Name this shape. How many sides? How many angles?**

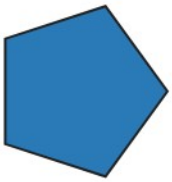

Shape: _____

Sides: ☐

Angles: ☐

---

2 **The rectangle has 2 rows and 5 columns of squares. How many squares in all?**

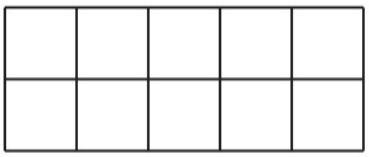

Squares: ☐

---

3 **Shade one half.**



One share is a ☐

---

4 **Name this shape. How many sides? How many angles?**

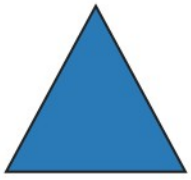

Shape: _____

Sides: ☐

Angles: ☐