Math Practice - Grade 1

M9 Time to the hour and half hour, and data

M9 1.MD.B.3, 1.MD.C.4

Name: _____ Date: _____

Tell the time. Read the picture graph.

1 **What time is it? Write the time.**



Time: ☐

---

2 **Circle the digital time that matches the clock.**



8:00 4:00 12:30

---

3 **How many in all?**

Apples 

Bananas 

Oranges 

---

4 **What time is it? Write the time.**



Time: ☐

Math Practice - Grade 1

M9 Time to the hour and half hour, and data

M9 1.MD.B.3, 1.MD.C.4

Name: _____ Date: _____

Tell the time. Read the picture graph.

1 **What time is it? Write the time.**



Time: ☐

---

2 **Circle the digital time that matches the clock.**



4:00 11:30 7:00

---

3 **How many in all?**

Apples 

Bananas 

Oranges 

---

4 **What time is it? Write the time.**



Time: ☐

Math Practice - Grade 1

M9 Time to the hour and half hour, and data

M9 1.MD.B.3, 1.MD.C.4

Name: _____ Date: _____

Tell the time. Read the picture graph.

1 **What time is it? Write the time.**



Time: ☐

---

2 **Circle the digital time that matches the clock.**



6:30 12:30 4:30

---

3 **Which has the most?**

Apples 

Bananas 

Oranges 

---

4 **What time is it? Write the time.**



Time: ☐