Math Practice - Grade 1

M8 Measure length

M8 1.MD.A.1, 1.MD.A.2

Name: _____ Date: _____

Order the bars. Measure how many units long.

1 **Write 1, 2, 3 next to the bars, from shortest to longest.**

Top  ☐

Middle  ☐

Bottom  ☐

---

2 **How many units long is the bar?**

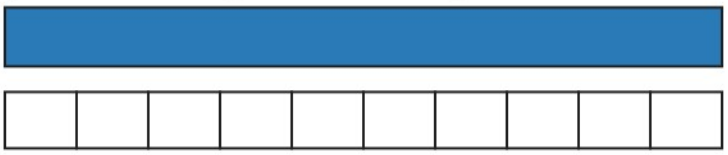

Units: ☐

---

3 **Write 1, 2, 3 next to the bars, from shortest to longest.**

Top  ☐

Middle  ☐

Bottom  ☐

---

4 **How many units long is the bar?**

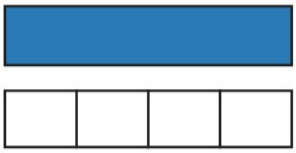

Units: ☐

---

5 **Write 1, 2, 3 next to the bars, from shortest to longest.**

Top  ☐

Middle  ☐

Bottom  ☐

Math Practice - Grade 1

M8 Measure length

M8 1.MD.A.1, 1.MD.A.2

Name: _____ Date: _____

Order the bars. Measure how many units long.

1 **Write 1, 2, 3 next to the bars, from shortest to longest.**

Top 

Middle 

Bottom 

---

2 **How many units long is the bar?**

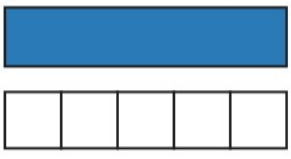

Units: _____

---

3 **Write 1, 2, 3 next to the bars, from shortest to longest.**

Top 

Middle 

Bottom 

---

4 **How many units long is the bar?**



Units: _____

---

5 **Write 1, 2, 3 next to the bars, from shortest to longest.**

Top 

Middle 

Bottom 

Math Practice - Grade 1

M8 Measure length

M8 1.MD.A.1, 1.MD.A.2

Name: _____ Date: _____

Order the bars. Measure how many units long.

1 **Write 1, 2, 3 next to the bars, from shortest to longest.**

Top 

Middle 

Bottom 

---

2 **How many units long is the bar?**

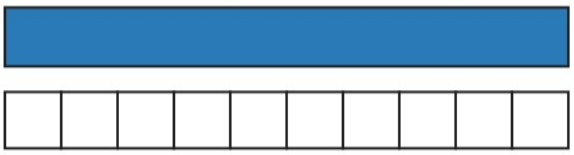

Units: _____

---

3 **Write 1, 2, 3 next to the bars, from shortest to longest.**

Top 

Middle 

Bottom 

---

4 **How many units long is the bar?**

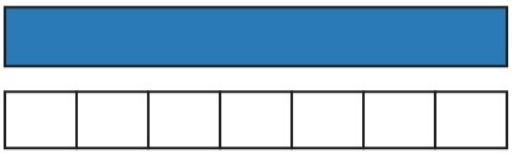

Units: _____

---

5 **Write 1, 2, 3 next to the bars, from shortest to longest.**

Top 

Middle 

Bottom 