Math Practice - Grade 1

M4 Add and subtract within 20, make a ten

M4 1.OA.C.6, 1.OA.B.3

Name: _____ Date: _____

Add and subtract within 20. Make a ten.

1 **Subtract.**

18 - 13 = ☐

2 **Make a ten. What is 5 + 6?**

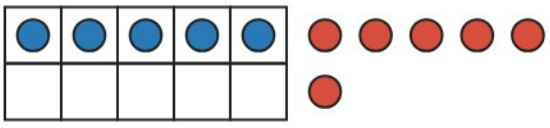

5 + 6 = ☐

3 **Subtract.**

14 - 10 = ☐

4 **Make a ten. What is 9 + 3?**

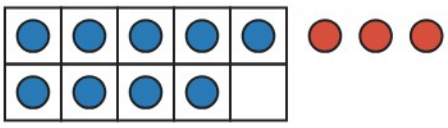

9 + 3 = ☐

5 **Subtract.**

16 - 16 = ☐

6 **Make a ten. What is 3 + 8?**

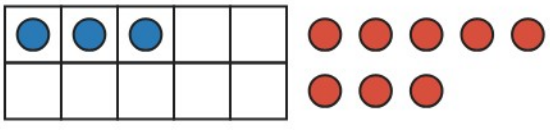

3 + 8 = ☐

Math Practice - Grade 1

M4 Add and subtract within 20, make a ten

M4 1.OA.C.6, 1.OA.B.3

Name: _____ Date: _____

Add and subtract within 20. Make a ten.

1 **Subtract.**

16 - 1 = ☐

2 **Make a ten. What is 7 + 8?**

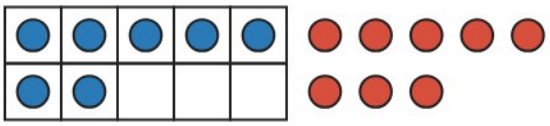

7 + 8 = ☐

3 **Add.**

9 + 3 = ☐

4 **Make a ten. What is 6 + 9?**

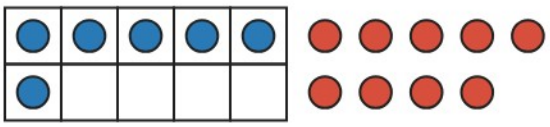

6 + 9 = ☐

5 **Add.**

8 + 6 = ☐

6 **Make a ten. What is 2 + 9?**

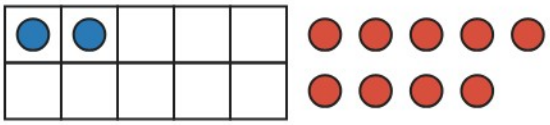

2 + 9 = ☐

Math Practice - Grade 1

M4 Add and subtract within 20, make a ten

M4 1.OA.C.6, 1.OA.B.3

Name: _____ Date: _____

Add and subtract within 20. Make a ten.

1 **Subtract.**

$$14 - 4 = \square$$

2 **Make a ten. What is 4 + 8?**

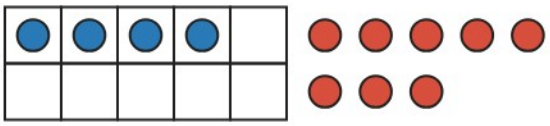

$$4 + 8 = \square$$

3 **Add.**

$$6 + 7 = \square$$

4 **Make a ten. What is 2 + 9?**

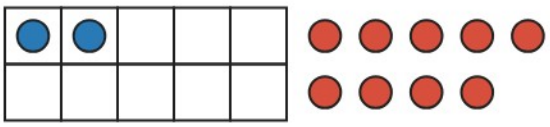

$$2 + 9 = \square$$

5 **Add.**

$$8 + 7 = \square$$

6 **Make a ten. What is 8 + 3?**

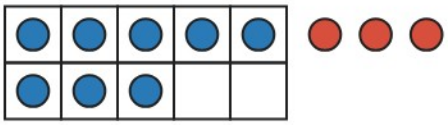

$$8 + 3 = \square$$