Math Practice - Grade 1

M2 Tens and ones

M2 1.NBT.B.2, 1.NBT.B.2a, 1.NBT.B.2b, 1.NBT.B.2c, 1.NBT.B.3

Name: _____ Date: _____

How many tens? How many ones? Compare the numbers.

1 **How many tens? How many ones?**

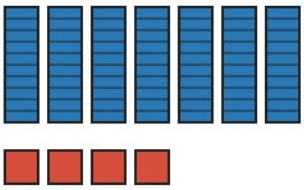

Tens: ☐

Ones: ☐

---

2 **Write > or < or = in the box.**

77 ☐ 15

---

3 **How many tens? How many ones?**

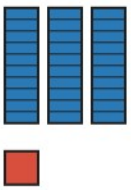

Tens: ☐

Ones: ☐

---

4 **Write > or < or = in the box.**

69 ☐ 22

---

5 **How many tens? How many ones?**



Tens: ☐

Ones: ☐

Math Practice - Grade 1

M2 Tens and ones

M2 1.NBT.B.2, 1.NBT.B.2a, 1.NBT.B.2b, 1.NBT.B.2c, 1.NBT.B.3

Name: _____ Date: _____

How many tens? How many ones? Compare the numbers.

1 **How many tens? How many ones?**

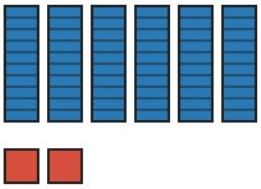

Tens: ☐

Ones: ☐

---

2 **Write > or < or = in the box.**

82 ☐ 50

---

3 **How many tens? How many ones?**



Tens: ☐

Ones: ☐

---

4 **Write > or < or = in the box.**

48 ☐ 81

---

5 **How many tens? How many ones?**

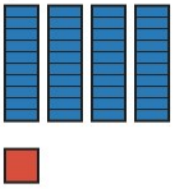

Tens: ☐

Ones: ☐

Math Practice - Grade 1

M2 Tens and ones

M2 1.NBT.B.2, 1.NBT.B.2a, 1.NBT.B.2b, 1.NBT.B.2c, 1.NBT.B.3

Name: _____ Date: _____

How many tens? How many ones? Compare the numbers.

1 **How many tens? How many ones?**

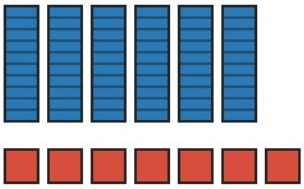

Tens: ☐

Ones: ☐

---

2 **Write > or < or = in the box.**

31 ☐ 31

---

3 **How many tens? How many ones?**

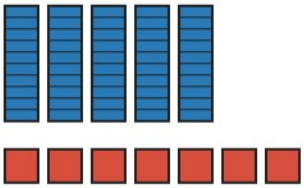

Tens: ☐

Ones: ☐

---

4 **Write > or < or = in the box.**

57 ☐ 57

---

5 **How many tens? How many ones?**

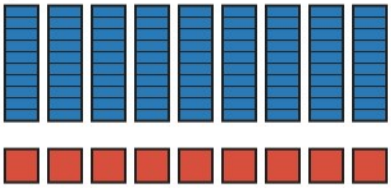

Tens: ☐

Ones: ☐