Math Practice - Grade 1

M10 Shapes, halves, and fourths

M10 1.G.A.1, 1.G.A.2, 1.G.A.3

Name: _____ Date: _____

Name the shape. Make a shape. Shade one share.

1 **Name this shape. How many sides? How many corners?**



Shape: _____

Sides: ☐

Corners: ☐

---

2 **Which two shapes make the triangle?**

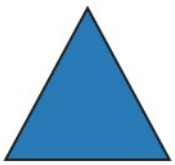

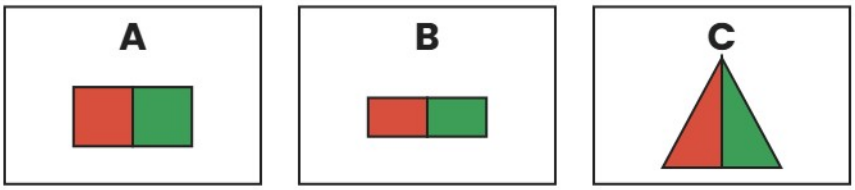

---

3 **Shade one fourth.**



One share is a ☐

---

4 **Name this shape. How many sides? How many corners?**



Shape: _____

Sides: ☐

Corners: ☐

---

5 **Which two shapes make the rectangle?**



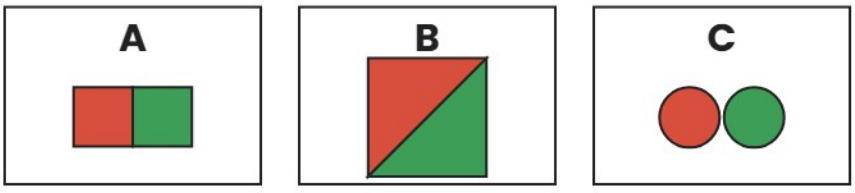

Math Practice - Grade 1

M10 Shapes, halves, and fourths

M10 1.G.A.1, 1.G.A.2, 1.G.A.3

Name: _____ Date: _____

Name the shape. Make a shape. Shade one share.

1 **Name this shape. How many sides? How many corners?**



Shape: _____

Sides: ☐

Corners: ☐

---

2 **Which two shapes make the rectangle?**



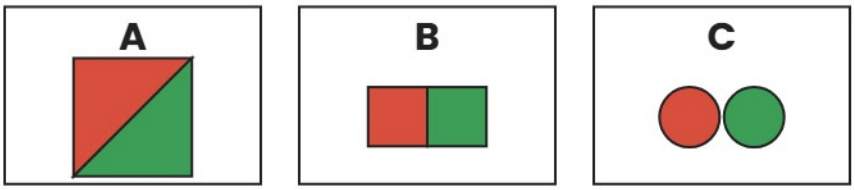

---

3 **Shade one half.**



One share is a ☐

---

4 **Name this shape. How many sides? How many corners?**



Shape: _____

Sides: ☐

Corners: ☐

---

5 **Which two shapes make the square?**



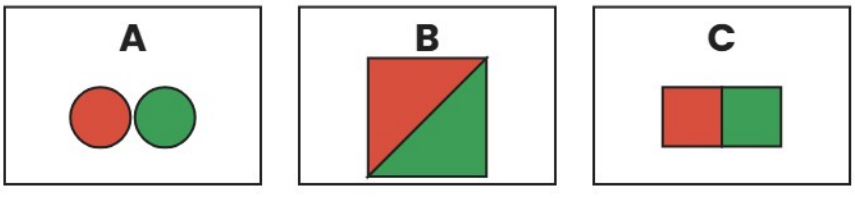

Math Practice - Grade 1

M10 Shapes, halves, and fourths

M10 1.G.A.1, 1.G.A.2, 1.G.A.3

Name: _____ Date: _____

Name the shape. Make a shape. Shade one share.

1 **Name this shape. How many sides? How many corners?**

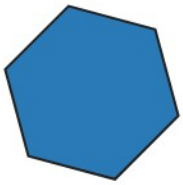

Shape: _____

Sides: ☐

Corners: ☐

---

2 **Which two shapes make the triangle?**

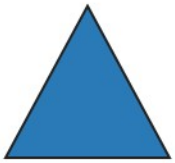

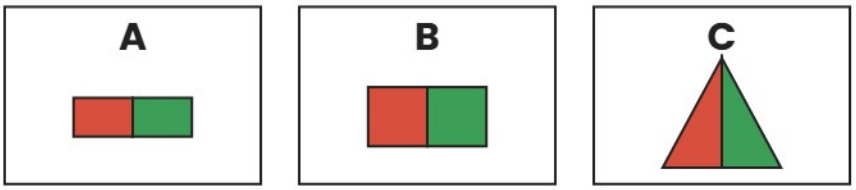

---

3 **Shade one half.**

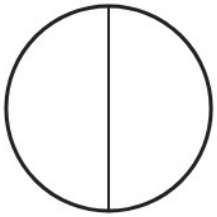

One share is a ☐

---

4 **Name this shape. How many sides? How many corners?**



Shape: _____

Sides: ☐

Corners: ☐

---

5 **Which two shapes make the triangle?**

