Math Practice - Grade 1

M1 Count to 120

M1 1.NBT.A.1

Name: _____ Date: _____

Count to 120. Fill in the missing numbers.

1 **Fill in the missing numbers on the chart.**

1	2	3	4	5	6	7	8	9	10
11	12	13	14	15		17	18	19	20
21	22	23	24	25	26	27	28	29	30
31	32	33	34	35	36	37	38	39	40
41	42	43	44	45	46	47	48	49	50
51	52	53	54	55	56	57		59	60
61	62	63	64	65	66	67	68	69	70
71	72	73	74	75	76	77	78	79	80
81	82	83	84	85		87	88	89	90
91	92	93	94	95	96	97	98	99	100
101	102	103	104	105	106	107	108	109	110
111	112	113	114	115	116		118	119	120

2 **Write the missing number on the number line.**

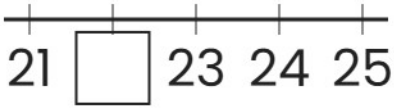

3 **Fill in the missing numbers on the chart.**

1	2	3	4	5	6	7	8	9	10
11	12	13	14	15	16	17	18	19	20
21	22	23		25	26	27	28	29	
31	32	33	34	35	36	37	38	39	40
41	42	43	44	45	46	47	48	49	50
51	52	53	54	55	56	57	58	59	60
61	62	63	64	65	66	67	68	69	70
71	72	73	74	75	76	77	78	79	80
81	82	83	84	85	86	87	88	89	90
91	92			95	96	97	98	99	100
101	102	103		105	106	107	108	109	110
111	112	113	114	115	116	117	118	119	120

Math Practice - Grade 1

M1 Count to 120

M1 1.NBT.A.1

Name: _____ Date: _____

Count to 120. Fill in the missing numbers.

1 **Fill in the missing numbers on the chart.**

1	2	3	4	5	6	7	8		10
11	12	13	14	15	16		18	19	20
21	22	23	24	25	26	27	28	29	30
31	32	33	34	35	36	37	38	39	40
41	42	43	44	45	46	47	48	49	50
	52	53	54	55	56	57	58	59	60
61	62	63	64	65	66	67	68	69	70
71	72	73	74	75	76	77	78	79	80
81		83	84	85	86	87	88	89	90
91	92	93	94	95	96	97	98	99	100
101	102	103	104	105	106	107	108	109	110
111	112	113	114	115	116	117	118	119	120

2 **Write the missing number on the number line.**

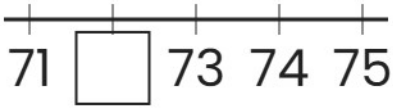

3 **Fill in the missing numbers on the chart.**

1	2	3	4	5	6	7	8	9	10
11	12	13	14	15	16	17	18	19	20
21	22	23	24	25	26	27	28	29	30
31	32	33	34	35	36	37	38		40
41	42	43	44	45	46	47	48	49	50
51	52	53	54	55	56	57	58	59	60
61	62	63	64	65	66	67	68	69	70
71	72	73	74	75	76	77	78	79	80
81	82	83	84	85	86	87	88	89	90
91	92	93	94	95	96		98	99	100
101	102	103	104			107	108	109	110
111	112	113	114	115		117	118	119	120

Math Practice - Grade 1

M1 Count to 120

M1 1.NBT.A.1

Name: _____ Date: _____

Count to 120. Fill in the missing numbers.

1 **Fill in the missing numbers on the chart.**

1	2	3	4	5	6	7	8	9	10
11	12	13	14	15	16		18	19	20
21	22	23	24	25	26	27	28	29	30
31	32	33	34	35	36	37	38	39	40
	42	43	44	45	46	47	48	49	50
51	52	53	54	55	56	57	58	59	60
61		63	64	65	66	67	68	69	70
71	72	73	74	75	76	77	78	79	80
81	82	83	84	85	86	87	88	89	90
91	92	93	94	95	96	97	98	99	100
101		103	104	105	106	107	108	109	110
111	112	113	114	115	116	117	118	119	120

2 **Write the missing number on the number line.**

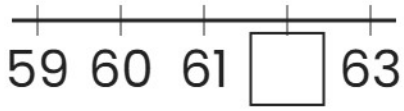

3 **Fill in the missing numbers on the chart.**

	2	3	4	5	6	7	8	9	10
	12	13	14	15	16	17	18	19	20
21	22	23		25	26	27	28	29	30
31	32	33	34	35	36	37	38	39	40
41	42	43	44	45	46	47	48	49	50
51	52	53	54	55	56	57	58	59	60
61	62	63	64	65	66	67	68	69	70
71	72	73	74	75	76	77	78	79	80
	82	83	84	85	86	87		89	90
91	92	93	94	95		97	98		100
101	102	103	104	105	106	107	108	109	110
111	112	113	114	115	116	117	118	119	120