Math Practice - Grade 1

M1 Count to 120

M1 1.NBT.A.1

Name: _____ Date: _____

Count to 120. Fill in the missing numbers.

1 **Fill in the missing numbers on the chart.**

1	2	3	4	5	6	7	8	9	10
11	12	13	14	15		17	18	19	20
21	22	23	24	25	26	27	28	29	30
31	32	33	34	35	36	37	38	39	40
41	42	43	44	45	46	47	48	49	50
51	52	53	54	55	56	57		59	60
61	62	63	64	65	66	67	68	69	70
71	72	73	74	75	76	77	78	79	80
81	82	83	84	85		87	88	89	90
91	92	93	94	95	96	97	98	99	100
101	102	103	104	105	106	107	108	109	110
111	112	113	114	115	116		118	119	120

2 **Write the missing number on the number line.**

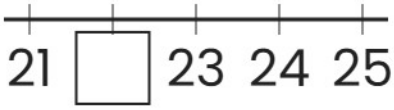

3 **Fill in the missing numbers on the chart.**

1	2	3	4	5	6	7	8	9	10
11	12	13	14	15	16	17	18	19	20
21	22	23		25	26	27	28	29	
31	32	33	34	35	36	37	38	39	40
41	42	43	44	45	46	47	48	49	50
51	52	53	54	55	56	57	58	59	60
61	62	63	64	65	66	67	68	69	70
71	72	73	74	75	76	77	78	79	80
81	82	83	84	85	86	87	88	89	90
91	92			95	96	97	98	99	100
101	102	103		105	106	107	108	109	110
111	112	113	114	115	116	117	118	119	120

Math Practice - Grade 1

M1 Count to 120

M1 1.NBT.A.1

Name: _____ Date: _____

Count to 120. Fill in the missing numbers.

1 **Fill in the missing numbers on the chart.**

1	2	3	4	5	6	7	8		10
11	12	13	14	15	16		18	19	20
21	22	23	24	25	26	27	28	29	30
31	32	33	34	35	36	37	38	39	40
41	42	43	44	45	46	47	48	49	50
	52	53	54	55	56	57	58	59	60
61	62	63	64	65	66	67	68	69	70
71	72	73	74	75	76	77	78	79	80
81		83	84	85	86	87	88	89	90
91	92	93	94	95	96	97	98	99	100
101	102	103	104	105	106	107	108	109	110
111	112	113	114	115	116	117	118	119	120

2 **Write the missing number on the number line.**

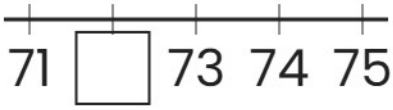

3 **Fill in the missing numbers on the chart.**

1	2	3	4	5	6	7	8	9	10
11	12	13	14	15	16	17	18	19	20
21	22	23	24	25	26	27	28	29	30
31	32	33	34	35	36	37	38		40
41	42	43	44	45	46	47	48	49	50
51	52	53	54	55	56	57	58	59	60
61	62	63	64	65	66	67	68	69	70
71	72	73	74	75	76	77	78	79	80
81	82	83	84	85	86	87	88	89	90
91	92	93	94	95	96		98	99	100
101	102	103	104			107	108	109	110
111	112	113	114	115		117	118	119	120

Math Practice - Grade 1

M1 Count to 120

M1 1.NBT.A.1

Name: _____ Date: _____

Count to 120. Fill in the missing numbers.

1 **Fill in the missing numbers on the chart.**

1	2	3	4	5	6	7	8	9	10
11	12	13	14	15	16		18	19	20
21	22	23	24	25	26	27	28	29	30
31	32	33	34	35	36	37	38	39	40
	42	43	44	45	46	47	48	49	50
51	52	53	54	55	56	57	58	59	60
61		63	64	65	66	67	68	69	70
71	72	73	74	75	76	77	78	79	80
81	82	83	84	85	86	87	88	89	90
91	92	93	94	95	96	97	98	99	100
101		103	104	105	106	107	108	109	110
111	112	113	114	115	116	117	118	119	120

2 **Write the missing number on the number line.**

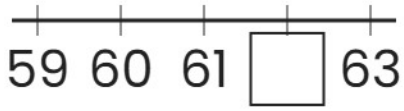

3 **Fill in the missing numbers on the chart.**

	2	3	4	5	6	7	8	9	10
	12	13	14	15	16	17	18	19	20
21	22	23		25	26	27	28	29	30
31	32	33	34	35	36	37	38	39	40
41	42	43	44	45	46	47	48	49	50
51	52	53	54	55	56	57	58	59	60
61	62	63	64	65	66	67	68	69	70
71	72	73	74	75	76	77	78	79	80
	82	83	84	85	86	87		89	90
91	92	93	94	95		97	98		100
101	102	103	104	105	106	107	108	109	110
111	112	113	114	115	116	117	118	119	120

Math Practice - Grade 1

M2 Tens and ones

M2 1.NBT.B.2, 1.NBT.B.2a, 1.NBT.B.2b, 1.NBT.B.2c, 1.NBT.B.3

Name: _____ Date: _____

How many tens? How many ones? Compare the numbers.

1 **How many tens? How many ones?**

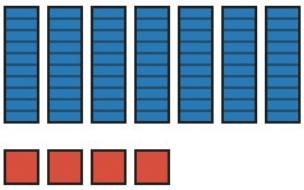

Tens: ☐

Ones: ☐

---

2 **Write > or < or = in the box.**

77 ☐ 15

---

3 **How many tens? How many ones?**

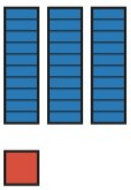

Tens: ☐

Ones: ☐

---

4 **Write > or < or = in the box.**

69 ☐ 22

---

5 **How many tens? How many ones?**



Tens: ☐

Ones: ☐

Math Practice - Grade 1

M2 Tens and ones

M2 1.NBT.B.2, 1.NBT.B.2a, 1.NBT.B.2b, 1.NBT.B.2c, 1.NBT.B.3

Name: _____ Date: _____

How many tens? How many ones? Compare the numbers.

1 **How many tens? How many ones?**

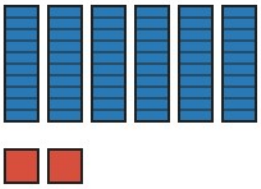

Tens: ☐

Ones: ☐

---

2 **Write > or < or = in the box.**

82 ☐ 50

---

3 **How many tens? How many ones?**



Tens: ☐

Ones: ☐

---

4 **Write > or < or = in the box.**

48 ☐ 81

---

5 **How many tens? How many ones?**

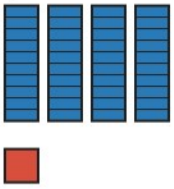

Tens: ☐

Ones: ☐

Math Practice - Grade 1

M2 Tens and ones

M2 1.NBT.B.2, 1.NBT.B.2a, 1.NBT.B.2b, 1.NBT.B.2c, 1.NBT.B.3

Name: _____ Date: _____

How many tens? How many ones? Compare the numbers.

1 **How many tens? How many ones?**

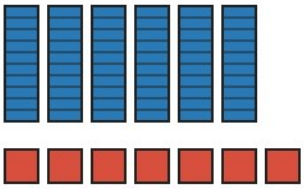

Tens: ☐

Ones: ☐

---

2 **Write > or < or = in the box.**

31 ☐ 31

---

3 **How many tens? How many ones?**

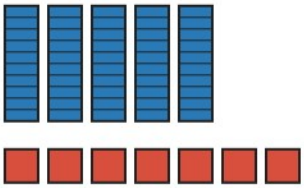

Tens: ☐

Ones: ☐

---

4 **Write > or < or = in the box.**

57 ☐ 57

---

5 **How many tens? How many ones?**

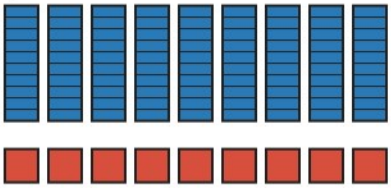

Tens: ☐

Ones: ☐

Math Practice - Grade 1

M3 Add and subtract within 10, fluently

M3 1.OA.C.5, 1.OA.C.6

Name: _____ Date: _____

Add and subtract within 10.

1 **Add.** 10 + 0 = ☐	**2** **Subtract.** 10 - 7 = ☐
3 **Add.** 2 + 6 = ☐	**4** **Subtract.** 3 - 2 = ☐
5 **Add.** 2 + 3 = ☐	**6** **Subtract.** 0 - 0 = ☐
7 **Add.** 0 + 4 = ☐	**8** **Subtract.** 5 - 2 = ☐
9 **Add.** 9 + 1 = ☐	**10** **Subtract.** 5 - 4 = ☐
11 **Add.** 4 + 3 = ☐	**12** **Subtract.** 4 - 1 = ☐
13 **Add.** 1 + 4 = ☐	**14** **Subtract.** 8 - 4 = ☐
15 **Add.** 9 + 0 = ☐	**16** **Subtract.** 2 - 1 = ☐
17 **Add.** 3 + 4 = ☐	**18** **Subtract.** 7 - 4 = ☐
19 **Add.** 7 + 3 = ☐	**20** **Subtract.** 6 - 2 = ☐

Math Practice - Grade 1

M3 Add and subtract within 10, fluently

M3 1.OA.C.5, 1.OA.C.6

Name: _____ Date: _____

Add and subtract within 10.

1 **Add.**

6 + 3 = ☐

2 **Subtract.**

2 - 0 = ☐

3 **Add.**

0 + 6 = ☐

4 **Subtract.**

9 - 7 = ☐

5 **Add.**

2 + 6 = ☐

6 **Subtract.**

5 - 3 = ☐

7 **Add.**

5 + 5 = ☐

8 **Subtract.**

8 - 2 = ☐

9 **Add.**

0 + 2 = ☐

10 **Subtract.**

5 - 4 = ☐

11 **Add.**

1 + 2 = ☐

12 **Subtract.**

5 - 1 = ☐

13 **Add.**

5 + 0 = ☐

14 **Subtract.**

8 - 4 = ☐

15 **Add.**

0 + 1 = ☐

16 **Subtract.**

10 - 8 = ☐

17 **Add.**

0 + 10 = ☐

18 **Subtract.**

6 - 2 = ☐

19 **Add.**

3 + 2 = ☐

20 **Subtract.**

6 - 1 = ☐

Math Practice - Grade 1

M3 Add and subtract within 10, fluently

M3 1.OA.C.5, 1.OA.C.6

Name: _____ Date: _____

Add and subtract within 10.

1 **Add.**

4 + 6 = ☐

2 **Subtract.**

9 - 5 = ☐

3 **Add.**

5 + 2 = ☐

4 **Subtract.**

9 - 0 = ☐

5 **Add.**

8 + 1 = ☐

6 **Subtract.**

7 - 0 = ☐

7 **Add.**

1 + 1 = ☐

8 **Subtract.**

8 - 4 = ☐

9 **Add.**

6 + 3 = ☐

10 **Subtract.**

5 - 2 = ☐

11 **Add.**

8 + 0 = ☐

12 **Subtract.**

10 - 7 = ☐

13 **Add.**

0 + 1 = ☐

14 **Subtract.**

3 - 0 = ☐

15 **Add.**

2 + 2 = ☐

16 **Subtract.**

0 - 0 = ☐

17 **Add.**

8 + 2 = ☐

18 **Subtract.**

3 - 1 = ☐

19 **Add.**

4 + 3 = ☐

20 **Subtract.**

6 - 6 = ☐

Math Practice - Grade 1

M4 Add and subtract within 20, make a ten

M4 1.OA.C.6, 1.OA.B.3

Name: _____ Date: _____

Add and subtract within 20. Make a ten.

1 **Subtract.**

18 - 13 = ☐

2 **Make a ten. What is 5 + 6?**

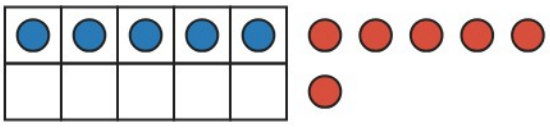

5 + 6 = ☐

3 **Subtract.**

14 - 10 = ☐

4 **Make a ten. What is 9 + 3?**

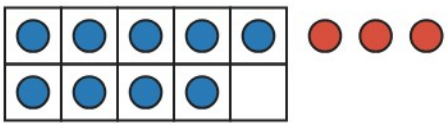

9 + 3 = ☐

5 **Subtract.**

16 - 16 = ☐

6 **Make a ten. What is 3 + 8?**

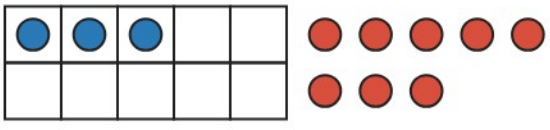

3 + 8 = ☐

Math Practice - Grade 1

M4 Add and subtract within 20, make a ten

M4 1.OA.C.6, 1.OA.B.3

Name: _____ Date: _____

Add and subtract within 20. Make a ten.

1 **Subtract.**

16 - 1 = ☐

2 **Make a ten. What is 7 + 8?**

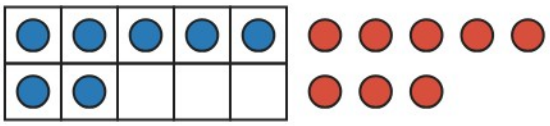

7 + 8 = ☐

3 **Add.**

9 + 3 = ☐

4 **Make a ten. What is 6 + 9?**

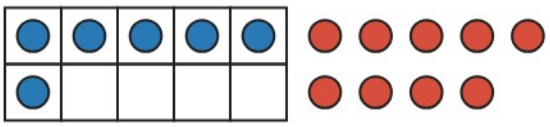

6 + 9 = ☐

5 **Add.**

8 + 6 = ☐

6 **Make a ten. What is 2 + 9?**

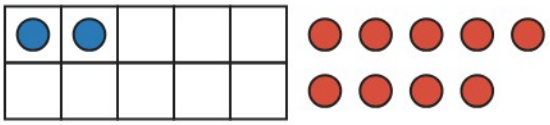

2 + 9 = ☐

Math Practice - Grade 1

M4 Add and subtract within 20, make a ten

M4 1.OA.C.6, 1.OA.B.3

Name: _____ Date: _____

Add and subtract within 20. Make a ten.

1 **Subtract.**

$$14 - 4 = \square$$

2 **Make a ten. What is 4 + 8?**

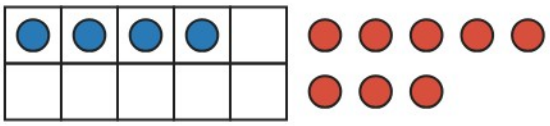

$$4 + 8 = \square$$

3 **Add.**

$$6 + 7 = \square$$

4 **Make a ten. What is 2 + 9?**

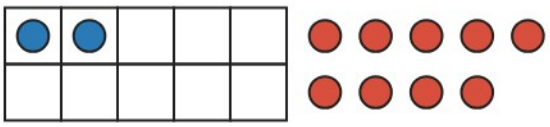

$$2 + 9 = \square$$

5 **Add.**

$$8 + 7 = \square$$

6 **Make a ten. What is 8 + 3?**

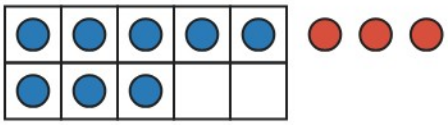

$$8 + 3 = \square$$

Math Practice - Grade 1

M5 Word problems within 20

M5 1.OA.A.1, 1.OA.A.2, 1.OA.D.8

Name: _____ Date: _____

Read the story. Write the number sentence and the answer.

1 **Noah has some crayons. Noah gets 5 more. Now Noah has 17. How many crayons did Noah have at first?**

$\square + 5 = 17$

---

2 **Liam has 15 crayons. Liam gives 15 to a friend. How many crayons are left?**

$15 - 15 = \square$

---

3 **Noah has 1 red book and 4 blue books. How many books does Noah have in all?**

$1 + 4 = \square$

---

4 **Liam has 5 marbles. Noah has 3 marbles. How many fewer marbles does Noah have than Liam?**

$5 - 3 = \square$

Math Practice - Grade 1

M5 Word problems within 20

M5 1.OA.A.1, 1.OA.A.2, 1.OA.D.8

Name: _____ Date: _____

Read the story. Write the number sentence and the answer.

1 **Liam has some toy cars. Liam gets 14 more. Now Liam has 19. How many toy cars did Liam have at first?**

$\square + 14 = 19$

---

2 **Ben has 3 books. Ben gives 3 to a friend. How many books are left?**

$3 - 3 = \square$

---

3 **Zoe has 3 red stickers and 10 blue stickers. How many stickers does Zoe have in all?**

$3 + 10 = \square$

---

4 **Ella has 7 books. Noah has 1 book. How many more books does Ella have than Noah?**

$7 - 1 = \square$

Math Practice - Grade 1

M5 Word problems within 20

M5 1.OA.A.1, 1.OA.A.2, 1.OA.D.8

Name: _____ Date: _____

Read the story. Write the number sentence and the answer.

1 **Max has some stickers. Max gets 1 more. Now Max has 6. How many stickers did Max have at first?**

$\square + 1 = 6$

---

2 **Ben has 8 toy cars. Ben gives some to a friend. Now Ben has 7. How many toy car did Ben give away?**

$8 - \square = 7$

---

3 **Mia has 1 red book and 10 blue books. How many books does Mia have in all?**

$1 + 10 = \square$

---

4 **Noah has 18 toy cars. Mia has 10 toy cars. How many more toy cars does Noah have than Mia?**

$18 - 10 = \square$

Math Practice - Grade 1

M6 Subtraction as a missing addend, the equal sign

M6 1.OA.B.4, 1.OA.D.7

Name: _____ Date: _____

Fill in the missing number. Tell if the equation is true or false.

1 **Fill in the missing number.**

$7 + \square = 14$

2 **Circle True or False.**

$10 + 5 = 16$

True False

3 **Fill in the missing number.**

$\square - 1 = 9$

4 **Circle True or False.**

$8 - 8 = 2$

True False

5 **Fill in the missing number.**

$\square + 17 = 20$

6 **Circle True or False.**

$2 + 6 = 9$

True False

7 **Fill in the missing number.**

$5 + \square = 5$

8 **Circle True or False.**

$3 - 3 = 2$

True False

9 **Fill in the missing number.**

$\square - 0 = 8$

10 **Circle True or False.**

$10 - 9 = 0$

True False

11 **Fill in the missing number.**

$6 + \square = 20$

12 **Circle True or False.**

$0 + 1 = 3$

True False

13 **Fill in the missing number.**

$9 + \square = 9$

14 **Circle True or False.**

$7 - 3 = 2$

True False

15 **Fill in the missing number.**

$0 + \square = 8$

16 **Circle True or False.**

$9 + 8 = 15$

True False

17 **Fill in the missing number.**

$14 - \square = 10$

18 **Circle True or False.**

$7 - 0 = 9$

True False

Math Practice - Grade 1

M6 Subtraction as a missing addend, the equal sign

M6 1.OA.B.4, 1.OA.D.7

Name: _____ Date: _____

Fill in the missing number. Tell if the equation is true or false.

1 **Fill in the missing number.**

11 - ☐ = 10

2 **Circle True or False.**

9 + 6 = 17

True False

3 **Fill in the missing number.**

8 - ☐ = 6

4 **Circle True or False.**

3 + 2 = 3

True False

5 **Fill in the missing number.**

☐ - 5 = 5

6 **Circle True or False.**

5 - 3 = 3

True False

7 **Fill in the missing number.**

☐ - 14 = 4

8 **Circle True or False.**

3 = 7 - 6

True False

9 **Fill in the missing number.**

4 + ☐ = 8

10 **Circle True or False.**

8 + 8 = 18

True False

11 **Fill in the missing number.**

☐ + 13 = 20

12 **Circle True or False.**

7 - 3 = 5

True False

13 **Fill in the missing number.**

18 - ☐ = 13

14 **Circle True or False.**

5 + 5 = 12

True False

15 **Fill in the missing number.**

☐ + 1 = 6

16 **Circle True or False.**

10 + 1 = 13

True False

17 **Fill in the missing number.**

☐ - 0 = 19

18 **Circle True or False.**

6 + 5 = 9

True False

Math Practice - Grade 1

M6 Subtraction as a missing addend, the equal sign

M6 1.OA.B.4, 1.OA.D.7

Name: _____ Date: _____

Fill in the missing number. Tell if the equation is true or false.

1 **Fill in the missing number.**

5 + ☐ = 9

2 **Circle True or False.**

3 + 0 = 5

True False

3 **Fill in the missing number.**

☐ + 3 = 10

4 **Circle True or False.**

9 + 7 = 18

True False

5 **Fill in the missing number.**

☐ - 9 = 10

6 **Circle True or False.**

6 = 1 + 3

True False

7 **Fill in the missing number.**

☐ + 0 = 17

8 **Circle True or False.**

10 - 8 = 3

True False

9 **Fill in the missing number.**

☐ + 5 = 11

10 **Circle True or False.**

13 = 7 + 7

True False

11 **Fill in the missing number.**

7 + ☐ = 9

12 **Circle True or False.**

11 = 8 + 1

True False

13 **Fill in the missing number.**

☐ - 7 = 1

14 **Circle True or False.**

6 - 0 = 7

True False

15 **Fill in the missing number.**

1 + ☐ = 15

16 **Circle True or False.**

5 + 7 = 11

True False

17 **Fill in the missing number.**

☐ - 19 = 0

18 **Circle True or False.**

0 = 7 - 6

True False

Math Practice - Grade 1

M7 Add within 100, ten more and ten less, subtract multiples of 10

M7 1.NBT.C.4, 1.NBT.C.5, 1.NBT.C.6

Name: _____ Date: _____

Add within 100. Find 10 more and 10 less.

1 **Add.**

17 + 10 = ☐

2 **What is 10 less than 98?**

98 - 10 = ☐

3 **Subtract.**

40 - 40 = ☐

4 **Add.**

36 + 60 = ☐

5 **What is 10 less than 43?**

43 - 10 = ☐

6 **Subtract.**

90 - 40 = ☐

7 **Add.**

66 + 20 = ☐

8 **What is 10 less than 38?**

38 - 10 = ☐

9 **Subtract.**

40 - 20 = ☐

10 **Add.**

23 + 3 = ☐

11 **What is 10 more than 59?**

59 + 10 = ☐

12 **Subtract.**

10 - 10 = ☐

13 **Add.**

37 + 5 = ☐

14 **What is 10 more than 14?**

14 + 10 = ☐

15 **Subtract.**

50 - 50 = ☐

16 **Add.**

45 + 50 = ☐

17 **What is 10 more than 72?**

72 + 10 = ☐

18 **Subtract.**

70 - 10 = ☐

19 **Add.**

85 + 4 = ☐

20 **What is 10 more than 74?**

74 + 10 = ☐

Math Practice - Grade 1

M7 Add within 100, ten more and ten less, subtract multiples of 10

M7 1.NBT.C.4, 1.NBT.C.5, 1.NBT.C.6

Name: _____ Date: _____

Add within 100. Find 10 more and 10 less.

1 **Add.**

40 + 9 = ☐

2 **What is 10 less than 84?**

84 - 10 = ☐

3 **Subtract.**

80 - 30 = ☐

4 **Add.**

12 + 2 = ☐

5 **What is 10 less than 43?**

43 - 10 = ☐

6 **Subtract.**

90 - 30 = ☐

7 **Add.**

81 + 7 = ☐

8 **What is 10 less than 47?**

47 - 10 = ☐

9 **Subtract.**

40 - 30 = ☐

10 **Add.**

82 + 10 = ☐

11 **What is 10 less than 91?**

91 - 10 = ☐

12 **Subtract.**

50 - 10 = ☐

13 **Add.**

68 + 8 = ☐

14 **What is 10 less than 58?**

58 - 10 = ☐

15 **Subtract.**

80 - 80 = ☐

16 **Add.**

62 + 30 = ☐

17 **What is 10 more than 56?**

56 + 10 = ☐

18 **Subtract.**

20 - 10 = ☐

19 **Add.**

77 + 20 = ☐

20 **What is 10 less than 29?**

29 - 10 = ☐

Math Practice - Grade 1

M7 Add within 100, ten more and ten less, subtract multiples of 10

M7 1.NBT.C.4, 1.NBT.C.5, 1.NBT.C.6

Name: _____ Date: _____

Add within 100. Find 10 more and 10 less.

1 **Add.**

23 + 3 = ☐

2 **What is 10 less than 13?**

13 - 10 = ☐

3 **Subtract.**

90 - 40 = ☐

4 **Add.**

58 + 7 = ☐

5 **What is 10 less than 40?**

40 - 10 = ☐

6 **Subtract.**

20 - 20 = ☐

7 **Add.**

34 + 9 = ☐

8 **What is 10 more than 20?**

20 + 10 = ☐

9 **Subtract.**

50 - 40 = ☐

10 **Add.**

80 + 5 = ☐

11 **What is 10 less than 11?**

11 - 10 = ☐

12 **Subtract.**

50 - 50 = ☐

13 **Add.**

70 + 5 = ☐

14 **What is 10 less than 39?**

39 - 10 = ☐

15 **Subtract.**

40 - 40 = ☐

16 **Add.**

76 + 20 = ☐

17 **What is 10 less than 43?**

43 - 10 = ☐

18 **Subtract.**

10 - 10 = ☐

19 **Add.**

63 + 30 = ☐

20 **What is 10 less than 95?**

95 - 10 = ☐

Math Practice - Grade 1

M8 Measure length

M8 1.MD.A.1, 1.MD.A.2

Name: _____ Date: _____

Order the bars. Measure how many units long.

1 **Write 1, 2, 3 next to the bars, from shortest to longest.**

Top  ☐

Middle  ☐

Bottom  ☐

---

2 **How many units long is the bar?**

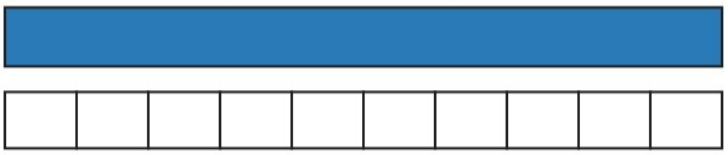

Units: ☐

---

3 **Write 1, 2, 3 next to the bars, from shortest to longest.**

Top  ☐

Middle  ☐

Bottom  ☐

---

4 **How many units long is the bar?**

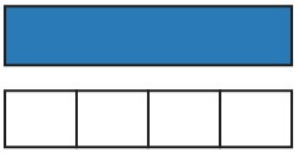

Units: ☐

---

5 **Write 1, 2, 3 next to the bars, from shortest to longest.**

Top  ☐

Middle  ☐

Bottom  ☐

Math Practice - Grade 1

M8 Measure length

M8 1.MD.A.1, 1.MD.A.2

Name: _____ Date: _____

Order the bars. Measure how many units long.

1 **Write 1, 2, 3 next to the bars, from shortest to longest.**

Top 

Middle 

Bottom 

---

2 **How many units long is the bar?**

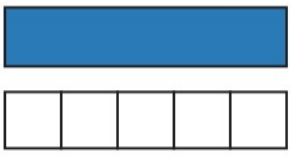

Units: _____

---

3 **Write 1, 2, 3 next to the bars, from shortest to longest.**

Top 

Middle 

Bottom 

---

4 **How many units long is the bar?**



Units: _____

---

5 **Write 1, 2, 3 next to the bars, from shortest to longest.**

Top 

Middle 

Bottom 

Math Practice - Grade 1

M8 Measure length

M8 1.MD.A.1, 1.MD.A.2

Name: _____ Date: _____

Order the bars. Measure how many units long.

1 **Write 1, 2, 3 next to the bars, from shortest to longest.**

Top 

Middle 

Bottom 

---

2 **How many units long is the bar?**

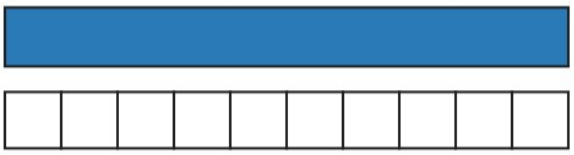

Units: _____

---

3 **Write 1, 2, 3 next to the bars, from shortest to longest.**

Top 

Middle 

Bottom 

---

4 **How many units long is the bar?**

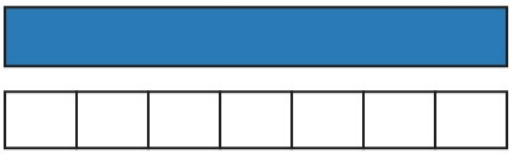

Units: _____

---

5 **Write 1, 2, 3 next to the bars, from shortest to longest.**

Top 

Middle 

Bottom 

Math Practice - Grade 1

M9 Time to the hour and half hour, and data

M9 1.MD.B.3, 1.MD.C.4

Name: _____ Date: _____

Tell the time. Read the picture graph.

1 **What time is it? Write the time.**



Time: ☐

---

2 **Circle the digital time that matches the clock.**



8:00 4:00 12:30

---

3 **How many in all?**

Apples 

Bananas 

Oranges 

---

4 **What time is it? Write the time.**



Time: ☐

Math Practice - Grade 1

M9 Time to the hour and half hour, and data

M9 1.MD.B.3, 1.MD.C.4

Name: _____ Date: _____

Tell the time. Read the picture graph.

1 **What time is it? Write the time.**



Time: ☐

---

2 **Circle the digital time that matches the clock.**



4:00 11:30 7:00

---

3 **How many in all?**

Apples 

Bananas 

Oranges 

---

4 **What time is it? Write the time.**



Time: ☐

Math Practice - Grade 1

M9 Time to the hour and half hour, and data

M9 1.MD.B.3, 1.MD.C.4

Name: _____ Date: _____

Tell the time. Read the picture graph.

1 **What time is it? Write the time.**



Time: ☐

---

2 **Circle the digital time that matches the clock.**



6:30 12:30 4:30

---

3 **Which has the most?**

Apples 

Bananas 

Oranges 

---

4 **What time is it? Write the time.**



Time: ☐

Math Practice - Grade 1

M10 Shapes, halves, and fourths

M10 1.G.A.1, 1.G.A.2, 1.G.A.3

Name: _____ Date: _____

Name the shape. Make a shape. Shade one share.

1 **Name this shape. How many sides? How many corners?**



Shape: _____

Sides: ☐

Corners: ☐

---

2 **Which two shapes make the triangle?**

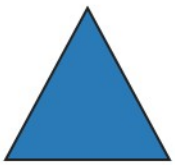

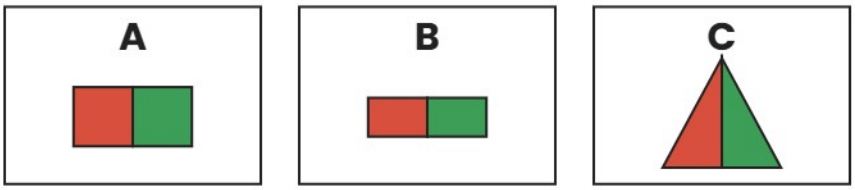

---

3 **Shade one fourth.**



One share is a ☐

---

4 **Name this shape. How many sides? How many corners?**



Shape: _____

Sides: ☐

Corners: ☐

---

5 **Which two shapes make the rectangle?**



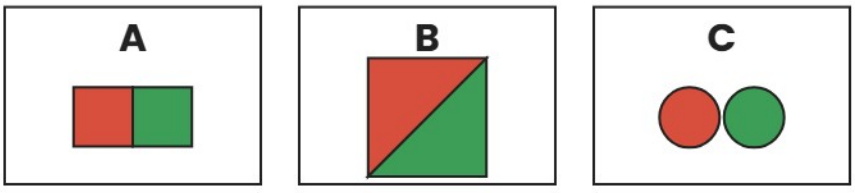

Math Practice - Grade 1

M10 Shapes, halves, and fourths

M10 1.G.A.1, 1.G.A.2, 1.G.A.3

Name: _____ Date: _____

Name the shape. Make a shape. Shade one share.

1 **Name this shape. How many sides? How many corners?**



Shape: _____

Sides: ☐

Corners: ☐

---

2 **Which two shapes make the rectangle?**



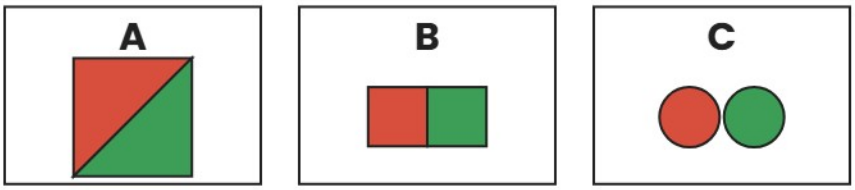

---

3 **Shade one half.**



One share is a ☐

---

4 **Name this shape. How many sides? How many corners?**



Shape: _____

Sides: ☐

Corners: ☐

---

5 **Which two shapes make the square?**



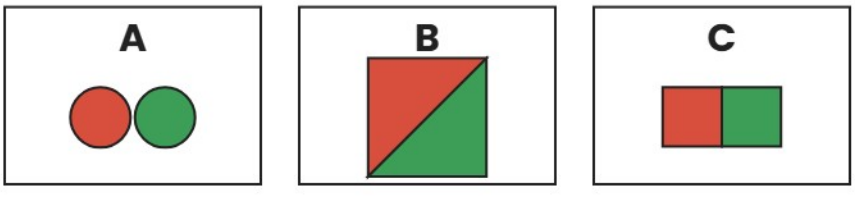

Math Practice - Grade 1

M10 Shapes, halves, and fourths

M10 1.G.A.1, 1.G.A.2, 1.G.A.3

Name: _____ Date: _____

Name the shape. Make a shape. Shade one share.

1 **Name this shape. How many sides? How many corners?**

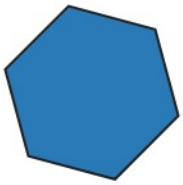

Shape: _____

Sides: ☐

Corners: ☐

---

2 **Which two shapes make the triangle?**

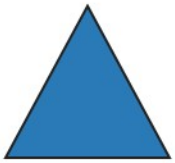

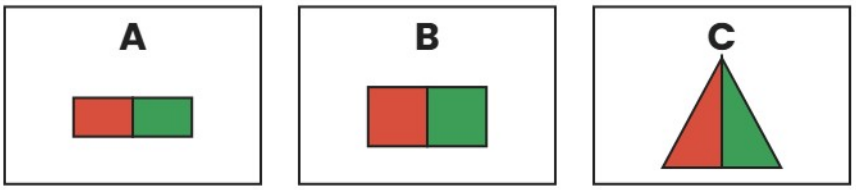

---

3 **Shade one half.**

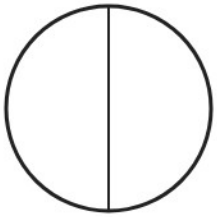

One share is a ☐

---

4 **Name this shape. How many sides? How many corners?**



Shape: _____

Sides: ☐

Corners: ☐

---

5 **Which two shapes make the triangle?**

